OPSC Exam- Mock Test, PYQS,Note, E-Books Get Now OnApp

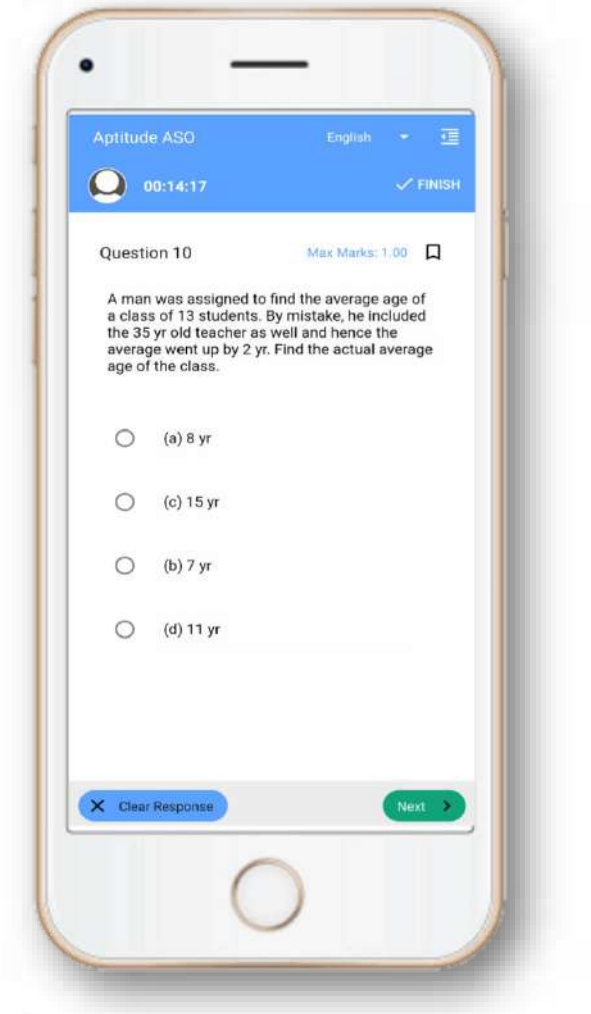

Tech Of World

Download App

GET IT ON Google Play

Click Here

YouTube- Click Here

Telegram- Click Here

Facebook- Click Here

Download Tech Of World App WtsApp/Call- 8596976190

DO NOT OPEN THIS TEST BOOKLET UNTIL YOU ARE ASKED TO DO SO

Test Booklet Series

A

TEST BOOKLET

RECRUITMENT OF A. S. O.

(A) ENGLISH LANGUAGE

(B) ODIA LANGUAGE

T. B. C. : ASG – 3/21

Sl. No. 629005

Time Allowed : 2 Hours

Techofworld.In

Maximum Marks : 200

: INSTRUCTIONS TO CANDIDATES :

1. IMMEDIATELY AFTER THE COMMENCEMENT OF THE EXAMINATION, YOU SHOULD CHECK THAT THIS TEST BOOKLET DOES NOT HAVE ANY UNPRINTED OR TORN OR MISSING PAGES OR ITEMS ETC. IF SO, GET IT REPLACED BY A COMPLETE TEST BOOKLET OF THE SAME SERIES ISSUED TO YOU.
2. ENCODE CLEARLY THE TEST BOOKLET SERIES A, B, C OR D, AS THE CASE MAY BE, IN THE APPROPRIATE PLACE IN THE ANSWER SHEET USING BALL POINT PEN (BLUE OR BLACK).
3. You have to enter your **Roll No.** on the Test Booklet in the Box provided alongside. **DO NOT** write *anything else* on the Test Booklet.

Techofworld.In

4. **YOU ARE REQUIRED TO FILL UP & DARKEN ROLL NO., TEST BOOKLET / QUESTION BOOKLET SERIES IN THE ANSWER SHEET AS WELL AS FILL UP TEST BOOKLET / QUESTION BOOKLET SERIES AND SERIAL NO. AND ANSWER SHEET SERIAL NO. IN THE ATTENDANCE SHEET CAREFULLY. WRONGLY FILLED UP ANSWER SHEETS ARE LIABLE FOR REJECTION AT THE RISK OF THE CANDIDATE.**
5. This Test Booklet contains **200** items (questions). i.e. Sl. No. **1** to **100** items (questions) for **English Language** and Sl. No. **101** to **200** items (questions) for **Odia Language**. Each item (question) comprises four responses (answers). You have to select the correct response (answer) which you want to mark (darken) on the Answer Sheet. In case, you feel that there is more than one correct response (answer) you should mark (darken) the response (answer) which you consider the best. In any case, choose **ONLY ONE** response (answer) for each item (question).
6. You have to mark (darken) all your responses (answers) **ONLY** on the **separate Answer Sheet** provided, by **using BALL POINT PEN (BLUE OR BLACK)**. See instructions in the Answer Sheet.
7. (i) All items (questions) carry equal marks. All items (questions) are compulsory. Your total marks will depend only on the number of correct responses (answers) marked by you in the Answer Sheet.

   (ii) There will be negative markings for wrong responses (answers). 25 (Twenty five) percentage of marks allotted to a particular item (question) will be deducted as negative marking for every wrong response (answer).

   (iii) If candidate give more than one response (answer), it will be treated as a wrong response (answer) even if one of the given responses (answers) happens to be correct and there will be same penalty as above to that item (question).
8. Before you proceed to mark (darken) in the Answer Sheet the responses (answers) to various items (questions) in the Test Booklet, you have to fill in some particulars in the Answer Sheet as per the instructions sent to you with your **Admission Certificate**.
9. After you have completed filling in all your responses (answers) on the Answer Sheet and after conclusion of the examination, you should hand over to the Invigilator the *Answer Sheet* issued to you. You are allowed to take with you the candidate's copy / second page of the Answer Sheet along with the **Test Booklet**, after completion of the examination, for your reference.
10. Sheets for rough work are appended in the Test Booklet at the end.

DO NOT OPEN THIS TEST BOOKLET UNTIL YOU ARE ASKED TO DO SO

Join Us-

Download Tech Of World App WtsApp/Call- 8596976190

(B) ODIA LANGUAGE

ନିର୍ଦ୍ଦେଶ (ପ୍ରଶ୍ନସଂଖ୍ୟା 101-110) : ଠିକ୍ ଶବ୍ଦ (ଉତ୍ତର) ଚିହ୍ନଟ କର :

101. (A) ଅନିର୍ବାର୍ଯ୍ୟ
(B) ଅନୀବାର୍ଯ୍ୟ
(C) ଅନିବାର୍ଯ୍ୟ
(D) ଅନିର୍ବାଯ୍ୟ

102. (A) ନିଷ୍ଫଳ
(B) ନିଷ୍ଫଳ
(C) ନିଃଷ୍ଫଳ
(D) ନୀଷ୍ଫଳ

103. (A) ଆର୍ଶିବାଦ
(B) ଆଶ୍ରିବାଦ
(C) ଆଶ୍ରୀବାଦ
(D) ଆଶୀର୍ବାଦ

104. (A) ଓତଃପୋତ
(B) ଓତଃପ୍ରୋତ
(C) ଓତପୋତ
(D) ଓତପ୍ରୋତ

105. (A) ପିୟୂଷ
(B) ପୀୟୂଷ
(C) ପିୟୁଷ
(D) ପୀୟୂଷ

106. (A) ପୂଜ୍ୟସ୍ପଦ
(B) ପୂଜାସ୍ପଦ
(C) ପୂଜାସ୍ପଦ
(D) ପୂଜ୍ୟାସ୍ପଦ

107. (A) ସାର୍ବଜନିନ
(B) ସର୍ବଜନୀନ
(C) ସର୍ବଜନିନ
(D) ସାର୍ବଜନୀନ

108. (A) ପାଦୁର୍ଭାବ
(B) ପ୍ରାର୍ଦୁଭାବ
(C) ପାର୍ଦୁଭାବ
(D) ପ୍ରାଦୁର୍ଭାବ

109. (A) ଅର୍ନ୍ତଯାମୀ
(B) ଅର୍ନ୍ତଯ୍ୟାମୀ
(C) ଅନ୍ତର୍ଯାମି
(D) ଅନ୍ତର୍ଯାମୀ

Techofworld.in

Join Us-

Download Tech Of World App WtsApp/Call- 8596976190

110. (A) ଦୂରବସ୍ତା

(B) ଦୂରାବସ୍ତା

(C) ଦୁରବସ୍ତା

(D) ଦୁରାବସ୍ତା

ନିର୍ଦ୍ଦେଶ (ପ୍ରଶ୍ନସଂଖ୍ୟା 111-120) : ଠିକ୍ ପ୍ରତିଶବ୍ଦଟି ବାଛ :

111. 'ଜଳଦ'ର ପ୍ରତିଶବ୍ଦ :

(A) ଜଳଧି

(B) ଅର୍ଣ୍ଣବ

(C) ଜୀମୂତ

(D) ପୟୋନିଧି

112. 'ଭାସ୍କର'ର ପ୍ରତିଶବ୍ଦ :

(A) ବିକର୍ତ୍ତନ

(B) ଅନଳ

(C) ମୃଗାଙ୍କ

(D) ବଳାହକ

113. 'ରାଜୀବ'ର ପ୍ରତିଶବ୍ଦ :

(A) ପ୍ରାଭଞ୍ଜନ

(B) ଆଦିତେୟ

(C) ସରସ

(D) ବିଶ୍ୱକେତୁ

114. 'ଦାନବ'ର ପ୍ରତିଶବ୍ଦ :

(A) ବ୍ରହ୍ମସୂ

(B) ଦନୁଜ

(C) ଗଙ୍ଗାସ୍ୟ

(D) ଅମୃତାନ୍ଦ

115. 'ଗାଭୀ'ର ପ୍ରତିଶବ୍ଦ :

(A) ଜାହ୍ନବୀ

(B) ରୋହିଣୀ

(C) ଅଦ୍ରି

(D) ଧେନୁ

116. 'ବିହଙ୍ଗ'ର ପ୍ରତିଶବ୍ଦ :

(A) ଦ୍ୱିଜ

(B) ବାରି

(C) ସରସୀରୁହ

(D) ବନଜ

117. 'ପର୍ବତ'ର ପ୍ରତିଶବ୍ଦ :

(A) କାସାର

(B) ମହୀଧର

(C) ଔଷଧୀଶ

(D) କୁଳିଶ

Techofworld.in

Join Us-

Download Tech Of World App WtsApp/Call- 8596976190

118. 'ନିକେତନ'ର ପ୍ରତିଶବ୍ଦ :

(A) ସଦ୍ମ

(B) ଭୂଧର

(C) ପାରାବାର

(D) ବିକର୍ତ୍ତନ

119. 'ଗଜ'ର ପ୍ରତିଶବ୍ଦ :

(A) ଗନ୍ଧବହ

(B) ତୁରଗ

(C) ଦ୍ୱିପ

(D) ଦ୍ୱିଜ

120. 'ପୃଥିବୀ'ର ପ୍ରତିଶବ୍ଦ :

(A) ଶିଖୀ

(B) ଅଦ୍ରୀ

(C) ଶ୍ରୀ

(D) ବିଶ୍ୱମ୍ଭରା

ନିର୍ଦ୍ଦେଶ (ପ୍ରଶ୍ନସଂଖ୍ୟା 121-130) : ବିପରୀତ ଶବ୍ଦ ଚୟନ କର :

121. 'ପ୍ରସନ୍ନ'ର ବିପରୀତ :

(A) ଦୁଃଖୀ

(B) ଅଧୀର

(C) କ୍ରୋଧାନ୍ୱିତ

(D) ବିଷଣ୍ଣ

122. 'କ୍ଷୀଣ'ର ବିପରୀତ :

(A) ବୃହତ୍

(B) ଅଧିକ

(C) ପୃଥୁଳ

(D) ସବଳ

123. 'ସଂକୀର୍ଣ୍ଣ'ର ବିପରୀତ :

(A) ସଂକୁଚିତ

(B) ପ୍ରଶସ୍ତ

(C) ଅନୁଦାର

(D) ସମାକୀର୍ଣ୍ଣ

124. 'ନିରପେକ୍ଷ'ର ବିପରୀତ :

(A) ବିପକ୍ଷ

(B) ପକ୍ଷପାତୀ

(C) ପ୍ରତ୍ୟକ୍ଷ

(D) ସହପକ୍ଷ

125. 'ମସୃଣ'ର ବିପରୀତ :

(A) ଚିକ୍କଣ

(B) ବନ୍ଧୁର

(C) ଚୌରସ

(D) କୋମଳ

Techofworld.In

Join Us-

Download Tech Of World App WtsApp/Call- 8596976190

126. 'ନିବୃତ୍ତ'ର ବିପରୀତ :

(A) ପ୍ରତ୍ୟାବୃତ୍ତ

(B) କ୍ଷାନ୍ତ

(C) ପ୍ରବୃତ୍ତ

(D) ବିବୃତ୍ତ

127. 'ସ୍ଥାବର'ର ପ୍ରତିଶବ୍ଦ :

(A) ଜଡ଼

(B) ଅଚଳ

(C) ଜଙ୍ଗମ

(D) ସ୍ଥିତିଶୀଳ

128. 'ନିଅଣ୍ଟ'ର ବିପରୀତ :

(A) ଅଭାବ

(B) ଅଘଟ

(C) ବହଳ

(D) ବଳକା

129. 'ପ୍ରସ୍ଥାନ'ର ବିପରୀତ :

(A) ଉତ୍ପନ୍ନ

(B) ଗମନ

(C) ପ୍ରେରଣ

(D) ପ୍ରବେଶ

130. 'ସମଷ୍ଟି'ର ବିପରୀତ :

(A) ବ୍ୟଷ୍ଟି

(B) ସାଜଲ୍ୟ

(C) ସଂହତି

(D) ସଂକ୍ଷେପଣ

131. କର୍ତ୍ତାପଦ ର ପୁରୁଷ ଓ ବଚନ ଅନୁସାରେ କ୍ରିୟାପଦ ର _____ ର ପରିବର୍ତ୍ତନ ହୁଏ ।

(A) କେବଳ ପୁରୁଷ

(B) କେବଳ ବଚନ

(C) ପୁରୁଷ ଓ ବଚନ

(D) ବିଭକ୍ତି

132. 'ପ୍ରତ୍ୟହ ଈଶ୍ୱରଙ୍କର ଉପାସନା କରିବା ବିଧେୟ' — ଉକ୍ତ ବାକ୍ୟରେ ବ୍ୟବହୃତ 'ଈଶ୍ୱରଙ୍କର' ପଦରେ କେଉଁ କାରକ ସମ୍ବନ୍ଧ ପ୍ରକାଶିତ ?

(A) କର୍ତ୍ତୃ

(B) କର୍ମ

(C) କରଣ

(D) ଅପାଦାନ

Techofworld.In
Join Us-

Download Tech Of World App WtsApp/Call- 8596976190

133. ଯେଉଁ କର୍ତ୍ତା ନିଜେ କ୍ରିୟା ସଂପାଦନ ନ କରି ଅନ୍ୟଦ୍ୱାରା କରାଏ, ତାହାକୁ _____ କୁହାଯାଏ ।

(A) ପ୍ରଯୁଜ୍ୟ କର୍ତ୍ତା

(B) ମୁଖ୍ୟ କର୍ତ୍ତା

(C) ପ୍ରୟୋଜକ କର୍ତ୍ତା

(D) ମୂଳକର୍ତ୍ତା

134. 'ପବନ ଅତି ଧୀରେ ବହୁଅଛି' — ଉକ୍ତ ବାକ୍ୟରେ କେଉଁଟି କ୍ରିୟା ବିଶେଷଣର ବିଶେଷଣ ?

(A) ପବନ

(B) ଅତି

(C) ଧୀରେ

(D) ବହୁଅଛି

135. 'ତିନି ମାସର ଦରମା' — ଏହି ବାକ୍ୟରେ ବ୍ୟବହୃତ 'ମାସର' ପଦର ସମ୍ବନ୍ଧ ଦର୍ଶାଅ :

(A) ନିର୍ଦ୍ଧାରଣ

(B) ବ୍ୟାପ୍ତି

(C) ବିଶେଷଣ

(D) କାର୍ଯ୍ୟକାରଣ

136. 'ସେମାନେ ଖେଳିଥିବେ' — ଏହା କେଉଁ କାଳସୂଚକ ?

(A) ସଂପନ୍ନ ଅତୀତ

(B) ଅସଂପନ୍ନ ଭବିଷ୍ୟତ

(C) ସଂପନ୍ନ ଭବିଷ୍ୟତ

(D) ସାଧାରଣ ଅତୀତ

137. ବାକ୍ୟରେ ସମାପିକା କ୍ରିୟାପଦ ସବୁବେଳେ ବାକ୍ୟର ଶେଷରେ ରହେ ।

(A) ଠିକ୍

(B) ଭୁଲ୍

(C) ଆଦୌ ରହେ ନାହିଁ

(D) କେଉଁଟି ବି ନୁହଁ

138. ଏକାଧିକ ପଦରେ ପ୍ରକାଶିତ କ୍ରିୟାକୁ _____ କୁହାଯାଏ ।

(A) ସମାପିକା କ୍ରିୟା

(B) ଅସମାପିକା କ୍ରିୟା

(C) ମିଶ୍ର କ୍ରିୟା

(D) ଅମିଶ୍ର କ୍ରିୟା

139. ଓଡ଼ିଆ ଭାଷାରେ କର୍ତ୍ତାର ଲିଙ୍ଗମତେ କ୍ରିୟାପଦର ପରିବର୍ତ୍ତନ _____ ।

(A) ହୁଏ

(B) ହୁଏ ନାହିଁ

(C) ବିଶେଷ କ୍ଷେତ୍ରରେ ହୋଇଥାଏ

(D) କେଉଁଟି ନୁହଁ

Techofworld.In

Join Us-

Download Tech Of World App WtsApp/Call- 8596976190

140. ଗୁଣବାଚକ ବିଶେଷ୍ୟର ବହୁବଚନ _____ ।

(A) କରାଯାଏ

(B) କରାଯାଇପାରେ

(C) କରାଯାଏ ନାହିଁ

(D) ବିଶେଷ କ୍ଷେତ୍ରରେ କରାଯାଏ

141. ବାକ୍ୟ ମଧ୍ୟରେ _____ ସର୍ବନାମ ପରସ୍ପରକୁ ଅପେକ୍ଷା କରନ୍ତି ।

(A) ବ୍ୟକ୍ତିବାଚକ

(B) ନିର୍ଦ୍ଦେଶାତ୍ମକ

(C) ସମ୍ବନ୍ଧବାଚକ

(D) ସମୁଚ୍ଚୟୀ

142. 'ଖେଳୁଅଛି' କ୍ରିୟାପଦର ପୁରୁଷ ଓ ବଚନ ନିର୍ଣ୍ଣୟ କର :

(A) ପ୍ରଥମ ପୁରୁଷ ବହୁବଚନ

(B) ତୃତୀୟ ପୁରୁଷ ବହୁବଚନ

(C) ଦ୍ୱିତୀୟ ପୁରୁଷ ଏକବଚନ

(D) ତୃତୀୟ ପୁରୁଷ ଏକବଚନ

143. 'ଦେଖ୍' ଧାତୁ ମୂଳ ସଂସ୍କୃତ _____ ଧାତୁରୁ ଆସିଛି ।

(A) ଦା

(B) ଧୃ

(C) ଖାଦ୍

(D) ଦୃଶ୍

144. 'ଗୁଣ ନ ଥିଲେ ଧନରେ କି ଫଳ' — ଉକ୍ତ ବାକ୍ୟରେ କେଉଁ ଅର୍ଥରେ 'ଧନ' ଶବ୍ଦର ତୃତୀୟା ବିଭକ୍ତି ହୋଇଛି ?

(A) ହେତୁ

(B) ପ୍ରୟୋଜନ

(C) ପ୍ରକୃତି

(D) ବିନିମୟ

145. କେଉଁଟି ଦେଶଜ ଧାତୁ ?

(A) ଉତ୍

(B) ବହ୍

(C) ଭିତ୍

(D) ଭୁଲ୍

146. ଯେଉଁ କ୍ରିୟାବାଚକ ବିଶେଷ୍ୟରୁ କାଳ, ପୁରୁଷ, ବଚନ ପ୍ରଭୃତିର ଧାରଣା ମିଳେ ନାହିଁ, ତାହା _____ ।

(A) ସଂପୂର୍ଣ୍ଣ କ୍ରିୟା

(B) ଦ୍ୱିକର୍ମକ କ୍ରିୟା

(C) ସିଦ୍ଧ କ୍ରିୟା

(D) ସାଧ୍ୟ କ୍ରିୟା

Techofworld.In

Join Us-

Download Tech Of World App WtsApp/Call- 8596976190

147. ବିଶେଷ୍ୟ ପଦଗୁଡ଼ିକ ବିଭକ୍ତିଯୁକ୍ତ ହେଲେ ବିଶେଷ୍ୟର ଆକୃତିରେ _____ ।

(A) ପରିବର୍ତ୍ତନ ଘଟେ

(B) ପରିବର୍ତ୍ତନ ଘଟେ ନାହିଁ

(C) କେତେକ କ୍ଷେତ୍ରରେ ପରିବର୍ତ୍ତନ ଘଟେ

(D) କେଉଁଟି ନୁହଁ

148. 'ହଳିଆକୁ' ଶବ୍ଦର ଗଠନ କ୍ଷେତ୍ରରେ _____ ।

(A) ସରଳ ପ୍ରକୃତି ସହ ପ୍ରତ୍ୟୟ ଯୋଗ ହୋଇଛି

(B) ସରଳ ପ୍ରକୃତି ସହ ବିଭକ୍ତି ଯୋଗ ହୋଇଛି

(C) ବ୍ୟୁତ୍ପନ୍ନ ପ୍ରକୃତି ସହ ବିଭକ୍ତି ଯୋଗ ହୋଇଛି

(D) ସରଳ ପ୍ରକୃତି ସହ କେଉଁଟି ବି ଯୋଗ ହୋଇନାହିଁ

149. ଧାତୁରେ ଅସମାପିକା କ୍ରିୟା ବିଭକ୍ତି _____ ।

(A) ସର୍ବଦା ଯୁକ୍ତ ହୁଏ

(B) ଆଦୌ ଯୁକ୍ତ ହୁଏ ନାହିଁ

(C) ଯୁକ୍ତ ହୋଇପାରେ

(D) କେଉଁଟି ନୁହଁ

150. କ୍ରିୟା ବହୁବଚନାନ୍ତ ହୋଇଥିଲେ କର୍ତ୍ତାରେ _____ ।

(A) ପୂର୍ବସର୍ଗ ଯୋଗ କରିବାକୁ ହୁଏ

(B) ପରସର୍ଗ ଯୋଗ କରିବାକୁ ହୁଏ

(C) ଉଭୟ ସର୍ଗ ଯୋଗ କରିବାକୁ ହୁଏ

(D) କୌଣସି ଗୋଟିଏ ସର୍ଗ ଯୋଗ କରିବା ଦରକାର ହୁଏ ନାହିଁ

151. 'କାଳିଦାସଙ୍କୁ ଭାରତର ସେକ୍‌ସପିଅର୍ କହନ୍ତି' —ଉକ୍ତ ବାକ୍ୟରେ 'ସେକ୍‌ସପିଅର୍' କେଉଁ ବିଶେଷ୍ୟ ରୂପେ ଗୃହୀତ ?

(A) ଜାତିବାଚକ

(B) ବସ୍ତୁବାଚକ

(C) ଗୁଣବାଚକ

(D) କ୍ରିୟାବାଚକ

152. 'ତପସ୍ୱୀ' ଶବ୍ଦ ଭିପରି ବିଶେଷ୍ୟରୁ ବିଶେଷଣରେ ପରିଣତ ହୋଇଛି, ଦର୍ଶାଅ ?

(A) ସ୍ୱତଃପ୍ରବୃତ୍ତ ଭାବେ

(B) ତଦ୍ଧିତ ପ୍ରକ୍ରିୟାରେ

(C) କୃଦନ୍ତ ପ୍ରକ୍ରିୟାରେ

(D) ଏକ ଭିନ୍ନ ପ୍ରକ୍ରିୟାରେ

153. 'ସିନା' ଏକ _____ ଅବ୍ୟୟ ।

(A) ବିକଳ୍ପାର୍ଥକ

(B) ନିଷେଧାର୍ଥକ

(C) ସମ୍ଭାବନାସୂଚକ

(D) ସମ୍ମତିସୂଚକ

Techofworld.in

Join Us-

Download Tech Of World App WtsApp/Call- 8596976190

154. କେଉଁଟି କ୍ରିୟାଜ ବିଶେଷଣ ?

(A) ପରମ ଦୟାଳୁ

(B) ହଜିଲା ଧନ

(C) ତୀକ୍ଷ୍ଣତର ଅସ୍ତ୍ର

(D) ପ୍ରଭୂତ ଶକ୍ତି

155. 'ମୁଁ ତାଙ୍କ ବିଷୟରେ ସବୁ ଜାଣେ'

— ଉକ୍ତ ବାକ୍ୟରେ 'ସବୁ' କେଉଁ ସର୍ବନାମ ?

(A) ଆତ୍ମବାଚକ

(B) ସମ୍ବନ୍ଧବାଚକ

(C) ଗୁରୁତ୍ୱ ଆରୋପକ

(D) ନିର୍ଣ୍ଣାୟକ

156. 'କ୍ବଳ୍' ଧାତୁରୁ _____ 'ଜାକ୍ବଲ୍ୟ' ଗଠିତ ।

(A) କର୍ମବାଚ୍ୟ ଧାତୁ

(B) ପ୍ରେରଣାର୍ଥକ କର୍ମବାଚ୍ୟ ଧାତୁ

(C) ନାମଧାତୁ

(D) ଅତିଶୟାର୍ଥକ ଧାତୁ

157. କେଉଁଟି ଶୁଦ୍ଧପଦ, ଦର୍ଶାଅ ?

(A) ନୀ + ତ୍ର = ନେତ୍ର

(B) ନ + ଏ + ତ୍ର = ନେତ୍ର

(C) ନେ + ତ୍ର + ଅ = ନେତ୍ର

(D) ନେ + ତ + ର = ନେତ୍ର

158. ସଂସ୍କୃତ 'ତୃ' ପ୍ରତ୍ୟୟ ଓଡ଼ିଆରେ _____ ହୁଏ ।

(A) ତ୍ର

(B) ତ୍ରି

(C) ତୀ

(D) ତା

159. କୃତ୍ ପ୍ରତ୍ୟୟରେ ସ୍ଥଳ ବିଶେଷରେ ବର୍ତ୍ତମାନଙ୍କର ପ୍ରଧାନତଃ _____ ପ୍ରକାରର ସାମାନ୍ୟ ପରିବର୍ତ୍ତନ ହୁଏ ।

(A) ଦୁଇ

(B) ତିନି

(C) ଚାରି

(D) ପାଞ୍ଚ

160. 'ଗଲି ଅଇଲି, ଯାହା ଦେଖିଲି ତାହା କହିଲି'

— ଉକ୍ତ ବାକ୍ୟରେ 'ଯାହା' ପଦର ସର୍ବନାମ ଚିହ୍ନିତ କର :

(A) ଆତ୍ମବାଚକ

(B) ନିର୍ଣ୍ଣାୟକ

(C) ନିର୍ଦ୍ଦେଶକ

(D) ସମ୍ବନ୍ଧବାଚକ

Techofworld.In

Join Us-

Download Tech Of World App WtsApp/Call- 8596976190

161. ଦ୍ୱିକର୍ମକ କ୍ରିୟାରେ ସାଧାରଣତଃ କେଉଁ କର୍ମ ଗୌଣ ?

(A) ପ୍ରାଣୀବାଚକ

(B) ଅପ୍ରାଣୀବାଚକ

(C) ସ୍ଥାନବାଚକ

(D) କାଳବାଚକ

162. ସର୍ବନାମରେ ବିଭକ୍ତି ଯୁକ୍ତ ହୋଇ ପରିବର୍ତ୍ତିତ ହୋଇଥିବା ପଦକୁ _____ କୁହାଯାଏ ।

(A) ପରିବର୍ତ୍ତିତ ଆକୃତି

(B) ମିଶ୍ର ଆକୃତି

(C) ଯୌଗିକ ଆକୃତି

(D) ତିର୍ଯ୍ୟକ ଆକୃତି

163. କେଉଁ କ୍ରିୟାପଦଟି ପ୍ରଥମପୁରୁଷ ଏକବଚନ ଓ ତୃତୀୟପୁରୁଷ ଏକବଚନ କ୍ଷେତ୍ରରେ ପ୍ରଯୁଜ୍ୟ ?

(A) ଖେଳୁଛି

(B) ଖେଳିବ

(C) ଖେଳିଲା

(D) ଖେଳୁଛନ୍ତି

164. ନିମ୍ନଲିଖିତ ପଦଗୁଡ଼ିକ ମଧ୍ୟରେ କେଉଁଟି ବୈଦେଶିକ ଅବ୍ୟୟଯୁକ୍ତ ପଦ ?

(A) ଫୀରୋଜ

(B) ସଠିକ୍

(C) ସଜୋର

(D) ବେଢଙ୍ଗ

165. 'ମାଧ୍ୟାକର୍ଷଣ-ଶକ୍ତି ସମସ୍ତ ଦ୍ରବ୍ୟକୁ ପୃଥିବୀକୁ ଆକର୍ଷିତ କରେ' — ଏହି ବାକ୍ୟରେ କେଉଁ ପଦ କର୍ତ୍ତାକାରକ ?

(A) ମାଧ୍ୟାକର୍ଷଣ ଶକ୍ତି

(B) ସମସ୍ତ

(C) ଦ୍ରବ୍ୟକୁ

(D) ପୃଥିବୀକୁ

166. ବାକ୍ୟରେ କ୍ରିୟାପଦ ସହିତ ଯେଉଁ ପଦର ଅନ୍ୱୟ ନ ଥାଏ, ତାହା _____ ।

(A) କର୍ତ୍ତାକାରକ

(B) କର୍ମକାରକ

(C) ସମ୍ବନ୍ଧପଦ

(D) ଅଧିକରଣ କାରକ

167. 'ସୈନ୍ୟମାନେ ଅସ୍ତ୍ର ଧରି ଯୁଦ୍ଧକୁ ଗଲେ' — ଏହି ବାକ୍ୟରେ 'ଧରି' ପଦ କେଉଁ କ୍ରିୟାକୁ ବୁଝାଉଛି ?

(A) ସମାପିକା

(B) ଅସମାପିକା

(C) ଦ୍ୱିକର୍ମକ

(D) କେଉଁଟିକୁ ନୁହଁ

Techofworld.In

Join Us-

Download Tech Of World App WtsApp/Call- 8596976190

168. 'ପିଲାମାନେ ପଢୁଥିବେ' — ଉକ୍ତ ବାକ୍ୟରେ ପଢୁଥିବେ କେଉଁ କାଳସୂଚକ ?

(A) ବିଶୁଦ୍ଧ ବର୍ତ୍ତମାନ

(B) ଆନୁମାନିକ ବର୍ତ୍ତମାନ

(C) ସମ୍ଭାବ୍ୟ ବର୍ତ୍ତମାନ

(D) ନିତ୍ୟପ୍ରବୃତ୍ତ ବର୍ତ୍ତମାନ

169. ଯାହା ସମ୍ବନ୍ଧରେ କୌଣସି କଥା କୁହାଯାଇଥାଏ, ତାହା _____ ।

(A) ବିଧେୟ

(B) ଉଦ୍ଦେଶ୍ୟ

(C) କ୍ରିୟା

(D) କ୍ରିୟାର ବିବର୍ଦ୍ଧକ

170. ସମ୍ବନ୍ଧ ପଦ ସହିତ କେଉଁ ବିଭକ୍ତି ଯୋଗ ହୁଏ ?

(A) ଚତୁର୍ଥୀ

(B) ଷଷ୍ଠୀ

(C) ସପ୍ତମୀ

(D) ପ୍ରଥମା

171. 'ଖେଳିବେ' କ୍ରିୟାପଦର ବିକରଣ ଚିହ୍ନିତ କର :

(A) ଖେଳ

(B) ଖେଳ୍

(C) ଇବ୍

(D) ଏ

172. କେଉଁଟି ଗୁଣବାଚକ ବିଶେଷ୍ୟ ?

(A) ଲୀନ

(B) ପୂର୍ଣ୍ଣ

(C) ଧୈର୍ଯ୍ୟ

(D) ମୁକ୍ତ

173. _____ ରୁ କ୍ରିୟାପଦର ପୁରୁଷ ଓ ବଚନ ଜଣାପଡ଼େ ।

(A) କାଳ

(B) ଧାତୁ

(C) ପ୍ରତ୍ୟୟ

(D) ବିଭକ୍ତି

174. ସମ୍ବୋଧନ ପଦର ପୂର୍ବରେ ଅଥବା ପରେ ଅବ୍ୟୟ ପଦ ଲାଗେ ।

(A) ଭୁଲ୍

(B) କେବେ ଲାଗେ ନାହିଁ

(C) ଠିକ୍

(D) କେଉଁଟି ନୁହଁ

Techofworld.in

Join Us-

Download Tech Of World App WtsApp/Call- 8596976190

175. କୌଣସି କାରକକୁ କ୍ରିୟାପଦ ନ ମିଳିଲେ ତାହା _____ ବଳରେ ଅନ୍ୟ କ୍ରିୟାପଦ ସହିତ ସଂପୃକ୍ତ ହୋଇଯାଏ ।

(A) କର୍ତ୍ତା

(B) ଅବ୍ୟୟ

(C) କ୍ରିୟା ବିଶେଷଣ

(D) ବିଭକ୍ତି

176. କେଉଁଟି ଯୌଗିକ ବାକ୍ୟ ?

(A) ତୁମେ ଯଦି ପୁରୀ ଯିବ, ମୋ ପାଇଁ ମହାପ୍ରସାଦ ଆଣିବ ।

(B) ଯେଉଁ ଲୋକ ନ୍ୟାୟ ପରାୟଣ, ତାକୁ ନ୍ୟାୟ ରକ୍ଷା କରେ ।

(C) ଗୋବିନ୍ଦ ବାବୁ ଗୋଟିଏ କଥା ଭାବୁଛନ୍ତି ଏବଂ ଦୁଃଖିତ ହେଉଛନ୍ତି ।

(D) ଆପଣ ମୋ କଥା ନ ଶୁଣନ୍ତୁ, ତଥାପି ମୁଁ କହିବି ।

177. ଯେଉଁ କ୍ରିୟାପଦ ବିଶେଷ୍ୟ ବା ବିଶେଷଣ ଶବ୍ଦରୁ ଗଠିତ ହୋଇଥାଏ, ତାହାକୁ _____ କ୍ରିୟାପଦ କୁହାଯାଏ ।

(A) ମିଶ୍ର

(B) ଅମିଶ୍ର

(C) ପ୍ରେରଣାର୍ଥକ

(D) ନାମଧାତୁ

178. 'ପବନ ଧୀରେ ବହୁଛି' — 'ବହୁଛି' କେଉଁ ଧରଣର କ୍ରିୟାପଦ ?

(A) ସକର୍ମକ

(B) ଅକର୍ମକ

(C) ଦ୍ୱିକର୍ମକ

(D) ପ୍ରେରଣାର୍ଥକ

179. 'ଋଷିମାନେ ବଣର ଫଳମୂଳ ଆହାର କରୁଥିଲେ' — ଉକ୍ତ ବାକ୍ୟର ଯୌଗିକ କ୍ରିୟା ଚିହ୍ନିତ କର :

(A) ବଣର

(B) ଫଳମୂଳ

(C) ଆହାର

(D) କରୁଥିଲେ

180. ପରସ୍ପର ଅନ୍ୱୟର ଉପଯୋଗୀ ଦୁଇ ବା ତତୋଧିକ ଶବ୍ଦକୁ ଏକପଦରେ ପରିଣତ କରିବାର ନାମ _____ ।

(A) ସନ୍ଧି

(B) ସମାସ ବାକ୍ୟ

(C) ପଦାନ୍ୱୟ

(D) ସମାସ

Techofworld.in

Join Us-

Download Tech Of World App WtsApp/Call- 8596976190

181. 'ଅନ୍ତା' _____ କାଳସୂଚକ ପ୍ରତ୍ୟୟ ।

(A) ନିତ୍ୟପ୍ରବୃତ୍ତ ଭବିଷ୍ୟତ

(B) ଅସଂପନ୍ନ ଭବିଷ୍ୟତ

(C) ପ୍ରାଗ୍ ଭବିଷ୍ୟତ

(D) ସମ୍ଭାବ୍ୟ ଭବିଷ୍ୟତ

182. ଧାତୁସହ ଅନ୍ୟୂନ _____ ବିଭକ୍ତିକୁ ଯୋଗ କରାଯାଇ କ୍ରିୟାପଦ ଗଠିତ ହୁଏ ।

(A) ଗୋଟିଏ

(B) ଦୁଇଟି

(C) ତିନୋଟି

(D) ଚାରୋଟି

183. ଯେଉଁ ରୂପିମ ଅନ୍ୟ କୌଣସି ରୂପିମର ବିନା ସାହାଯ୍ୟରେ ଭାଷାରେ ବ୍ୟବହୃତ ହୋଇପାରେ, ତାହାକୁ _____ କୁହାଯାଏ ।

(A) ମୁକ୍ତ ରୂପିମ

(B) ବଦ୍ଧ ରୂପିମ

(C) ରୂଢ଼ ଶବ୍ଦ

(D) ଯୋଗ ରୂଢ଼ ଶବ୍ଦ

184. ଓଡ଼ିଆ ଶବ୍ଦ ଗଠନରେ ବ୍ୟବହୃତ ରୂପିମଗୁଡ଼ିକୁ କେତୋଟି ଭାଗରେ ବିଭକ୍ତ କରାଯାଇଛି ?

(A) ଦୁଇ

(B) ପାଞ୍ଚ

(C) ତିନି

(D) ଚାରି

185. ଧାତୁସହ କେଉଁ ବିଭକ୍ତି ଯୁକ୍ତ ହେଲେ ଅସମାପିକା କ୍ରିୟା ହୁଏ ?

(A) ଲୁ

(B) ରୁ

(C) ଉ

(D) ର

186. ବିଶେଷ୍ୟ ପଦର ଏକବଚନ ଶବ୍ଦକୁ ବହୁବଚନ କରିବାବେଳେ ପୂର୍ବସର୍ଗ ଓ ପରସର୍ଗ ଉଭୟ ଲାଗେ ନାହିଁ ।

(A) ଠିକ୍

(B) ଭୁଲ୍

(C) ବିଶେଷ କ୍ଷେତ୍ରରେ ଲାଗେ

(D) କେଉଁଟି ନୁହଁ

187. ଅମୂର୍ତ୍ତବାଚକ ବିଶେଷ୍ୟଗୁଡ଼ିକୁ _____ ।

(A) ଦେଖିହୁଏ

(B) ସ୍ପର୍ଶ କରିହୁଏ

(C) ଅନୁଭବ କରିହୁଏ

(D) ଦେଖିହୁଏ ଏବଂ ସ୍ପର୍ଶ କରିହୁଏ

Techofworld.In

Join Us-

Download Tech Of World App WtsApp/Call- 8596976190

188. ବିଶେଷ୍ୟ ପଦ ପରେ ବ୍ୟବହୃତ ବିଶେଷଣ ପଦକୁ _____ ବିଶେଷଣ କୁହାଯାଏ ।

(A) ବିଶେଷ୍ୟର

(B) ବିଧେୟ

(C) ଗୁଣବାଚକ

(D) ଅବସ୍ଥାବାଚକ

189. 'ଦୈତ୍ୟ' ପଦରେ କେଉଁ ପ୍ରତ୍ୟୟ ଯୋଗ ହୋଇଛି ?

(A) ଅ

(B) ଇ

(C) ୟ

(D) ଏୟ

190. 'କପିଳଦେବଙ୍କ ଛଡ଼ା ଆଉ କିଏ ଏଭଳି ଛକା ମାରି ପାରିବ' — ଏହା କେଉଁ ଧରଣର ବାକ୍ୟ ?

(A) ବିବୃତିସୂଚକ

(B) ବିବୃତିମୂଳକ ନାସ୍ତିସୂଚକ

(C) ପ୍ରଶ୍ନସୂଚକ

(D) ବିସ୍ମୟସୂଚକ

191. ବିଶେଷ୍ୟ ପଦ 'ଅଙ୍କୁର'ରୁ _____ ଧାତୁ 'ଅଙ୍କୁରିବା' ଗଠିତ ।

(A) ପ୍ରଯୋଜନ

(B) ଣିଜନ୍ତ

(C) ସନନ୍ତ

(D) ନାମ

192. କେଉଁଟି ହେତୁବୋଧକ ଅବ୍ୟୟ ?

(A) ପରନ୍ତୁ

(B) ମାତ୍ର

(C) ସୁତରାଂ

(D) ଅଦ୍ୟାପି

193. ଶୁଦ୍ଧରୂପ ଚିହ୍ନଟ କର :

(A) ପ୍ରବଞ୍ଚନ

(B) ପ୍ରବର୍ଜ୍ଜନ

(C) ପ୍ରବଞ୍ଜନ

(D) ପ୍ରବ୍ରଜନ

194. ଣିଜନ୍ତ ଧାତୁ 'ଧାରି'ର ମୂଳଧାତୁ ଚିହ୍ନଟ କର :

(A) ଧ୍ର

(B) ଧା

(C) ଧ୍ରା

(D) ଧୃ

Techofworld.In

Join Us-

Download Tech Of World App WtsApp/Call- 8596976190

195. ନାମଧାତୁ 'ଆଗେଇବା'ର ବିଶେଷଣ ପଦ _____ ।

(A) ଆଗ

(B) ଆଗ୍

(C) ଅଗ

(D) ଆଗେଇ

196. କେଉଁଟି ଜଟିଳ ବାକ୍ୟ ?

(A) ଯେ ସର୍ବଦା ସତ୍ୟ କହେ, ସେ ନିର୍ଭୟ ।

(B) ସେ ତୁମକୁ ଗାଳିଦେଇଥିଲା । ସେ ଆସିଛି ।

(C) ସେ ଧନୀ, ମାତ୍ର ସୁଖୀ ନୁହଁନ୍ତି ।

(D) ସେ ପୁରୀ ଯାଇଥିବ କିମ୍ବା କଟକ ଯାଇଥିବ ।

Techofworld.in

197. 'କାର୍ତ୍ତିକେୟ' ଶବ୍ଦର ଶୁଦ୍ଧ ଗଠନ ରୂପ ଚିହ୍ନଟ କର :

(A) କାର୍ତ୍ତିକ + ଏୟ

(B) କାର୍ତ୍ତିକ + ୟ

(C) କାର୍ତ୍ତି + କେୟ

(D) କୃତ୍ତିକା + ଏୟ

198. କେତେକ ସକର୍ମକ କ୍ରିୟା ବ୍ୟବହାରରେ ଦ୍ୱିକର୍ମକ ହୁଏ ।

(A) ଭୁଲ୍

(B) ଠିକ୍

(C) ଆଦୌ ହୁଏ ନାହିଁ

(D) ସମସ୍ତ ସକର୍ମକ କ୍ରିୟା ବ୍ୟବହାରରେ ଦ୍ୱିକର୍ମକ ହୁଏ ।

199. 'ଶିକ୍ଷକ ଛାତ୍ରକୁ ପ୍ରଶ୍ନ ପଚାରିଲେ' — ଉକ୍ତ ବାକ୍ୟର ମୁଖ୍ୟ କର୍ମ ଚିହ୍ନଟ କର :

(A) ପ୍ରଶ୍ନ

(B) ଛାତ୍ରକୁ

(C) ଶିକ୍ଷକ

(D) ପଚାରିଲେ

200. 'ଉଚ୍ଚୁର'ର ବିପରୀତ ଅର୍ଥବୋଧକ ଶବ୍ଦ ବାଛ :

(A) ସଙ୍ଗେ ସଙ୍ଗେ

(B) ଶୀଘ୍ର

(C) ଜଲ୍‌ଦି

(D) ସଅଳ

Join Us-

OPSC Exam- Mock Test, PYQS,Note, E-Books Get Now OnApp

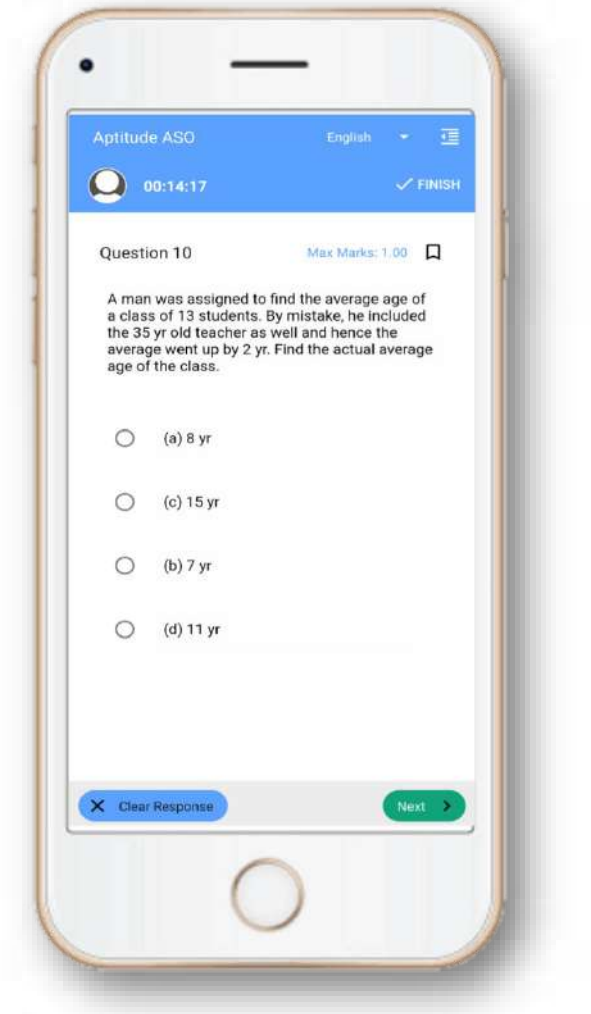

Tech Of World

Download App

GET IT ON Google Play

Click Here

YouTube- Click Here

Telegram- Click Here

Facebook- Click Here

Download Tech Of World App WtsApp/Call- 8596976190

DO NOT OPEN THIS TEST BOOKLET UNTIL YOU ARE ASKED TO DO SO

T. B. C. : ASG – 1/21

Test Booklet Series

A

TEST BOOKLET

RECRUITMENT OF A. S. O.

GENERAL AWARENESS

181905

Sl. No.

Time Allowed : 1½ Hours

Techofworld.In

Maximum Marks : 100

: INSTRUCTIONS TO CANDIDATES :

1. IMMEDIATELY AFTER COMMENCEMENT OF THE EXAMINATION, YOU SHOULD CHECK THAT THIS TEST BOOKLET **DOES NOT** HAVE ANY UNPRINTED OR TORN OR MISSING PAGES OR ITEMS ETC. IF SO, GET IT REPLACED BY A COMPLETE TEST BOOKLET OF THE SAME SERIES ISSUED TO YOU.
2. ENCODE CLEARLY THE TEST BOOKLET SERIES **A, B, C OR D**, AS THE CASE MAY BE, IN THE APPROPRIATE PLACE IN THE ANSWER SHEET USING BALL POINT PEN (BLUE OR BLACK).
3. You have to enter your **Roll No.** on the Test Booklet in the Box provided alongside. **DO NOT** write *anything else* on the Test Booklet. 675153 Techofworld.In
4. **YOU ARE REQUIRED TO FILL UP & DARKEN ROLL NO., TEST BOOKLET / QUESTION BOOKLET SERIES IN THE ANSWER SHEET AS WELL AS FILL UP TEST BOOKLET / QUESTION BOOKLET SERIES AND SERIAL NO. AND ANSWER SHEET SERIAL NO. IN THE ATTENDANCE SHEET CAREFULLY. WRONGLY FILLED UP ANSWER SHEETS ARE LIABLE FOR REJECTION AT THE RISK OF THE CANDIDATE.**
5. This Test Booklet contains **100** items (questions). Each item (question) comprises four responses (answers). You have to select the correct response (answer) which you want to mark (darken) on the Answer Sheet. In case, you feel that there is more than one correct response (answer), you should mark (darken) the response (answer) which you consider the best. In any case, choose **ONLY ONE** response (answer) for each item (question).
6. You have to mark (darken) all your responses (answers) **ONLY** on the **separate Answer Sheet** provided, by **using BALL POINT PEN (BLUE OR BLACK).** See instructions in the Answer Sheet.
7. (i) All items (questions) carry equal marks. All items (questions) are compulsory. Your total marks will depend only on the number of correct responses (answers) marked by you in the Answer Sheet. Techofworld.In

   (ii) There will be negative markings for wrong responses (answers). 25 (Twenty five) percentage of marks allotted to a particular item (question) will be deducted as negative marking for every wrong response (answer).

   (iii) If candidate give more than one response (answer), it will be treated as a wrong response (answer) even if one of the given responses (answers) happens to be correct and there will be same penalty as above to that item (question).
8. Before you proceed to mark (darken) in the Answer Sheet the responses (answers) to various items (questions) in the Test Booklet, you have to fill in some particulars in the Answer Sheet as per the instructions sent to you with your **Admission Certificate**.
9. After you have completed filling in all your responses (answers) on the Answer Sheet and after conclusion of the examination, you should hand over to the Invigilator the *Answer Sheet* issued to you. You are allowed to take with you the candidate's copy / second page of the Answer Sheet along with the **Test Booklet**, after completion of the examination, for your reference.
10. Sheets for rough work are appended in the Test Booklet at the end.

DO NOT OPEN THIS TEST BOOKLET UNTIL YOU ARE ASKED TO DO SO

Join Us-

Download Tech Of World App WtsApp/Call- 8596976190

1. In the guidelines announced by Union Finance Minister in the 2022-2023 Budget, instead of using the term 'Crypto Currency', the term _____ is used.

(A) Bitcoins Assets

(B) Ethercoins Assets

(C) Altcoins Assets

(D) Virtual Digital Assets

2. Which State in India presented 'Child Budget' as part of the Annual State Budget ?

(A) Andhra Pradesh

(B) Gujarat

(C) Sikkim

(D) Madhya Pradesh

3. The Government of India announced it's decision to convert 150 villages into 'Villages of Excellence' with technical assistance from _____.

(A) Japan

(B) Israel

(C) USA

(D) Netherlands

4. Which one of the following is not the objective of 'Operation Sajag' launched by Delhi Police ?

(A) To curb area domination exercise

(B) Keeping tap on criminals

(C) Intensive checking at pickets

(D) Special rewards to traffic-friendly drivers

5. The GSI has approved the setting up of country's first Geological Park at _____.

(A) Lamheta, Jabalpur

(B) Kadagu, Karnataka

(C) Idukki, Kerala

(D) Talala Gir, Gujarat

Techofworld.In

Join Us-

Download Tech Of World App WtsApp/Call- 8596976190

6. Match the following :

(I)	Meghalaya	(i)	Hojagiri
(II)	Mizoram	(ii)	Wangala Dance
(III)	Manipur	(iii)	Bamboo Dance
(IV)	Tripura	(iv)	Thang ta

(A) (I) – (ii), (II) – (iii), (III) – (iv), (IV) – (i)

(B) (I) – (iii), (II) – (i), (III) – (ii), (IV) – (iv)

(C) (I) – (ii), (II) – (i), (III) – (iii), (IV) – (iv)

(D) (I) – (iii), (II) – (iv), (III) – (i), (IV) – (iv)

7. The Central Board of Secondary Education has introduced 'Data Science Subject' as a subject for it's students of 8-12 class in collaboration with _____ company.

(A) Inter

(B) Dell

(C) Microsoft

(D) Infosys

8. Which of the following Statements is not correct ?

(A) Recently the Ministry of Earth Sciences has launched the Deep Ocean Mission

(B) This Mission mode project is to support the Green Economy initiative of Government of India

(C) This project is aimed to study bio-diversity, the impact of climate change etc

(D) In 2022 India signed a contract with International Sea Board Authority

Techofworld.In

Join Us-

Download Tech Of World App WtsApp/Call- 8596976190

9. Digital India 'BHASHINI' is _____.

(A) India's Artificial Intelligence-led Language Translation Platform

(B) It gives access to global content in their own languages

(C) It is a step to realize digital photography

(D) It promotes Digital India Vision

Which one of the above is not correct ?

10. The theme of 'Earth Day-2022 is _____.

(A) Nurture the Nature

(B) Go Green, Save Green

(C) Save the Earth, Save the Future

(D) Invest in our Planet

11. Which of the following statements is not correct ?

(I) The Chang'e5 Lunar Space Craft Mission is undertaken by China

(II) It found water at its landing site

(III) It is the third Lunar Exploration Mission of Russia

(IV) The Chang'e5 Lunar Space Craft was launched on November 23, 2020

(A) (II) and (IV)

(B) (III) only

(C) (IV) only

(D) (I) only

12. Which country recently passed a law to make 'ethnic unity' mandatory ?

(A) Tibet

(B) Vietnam

(C) Nepal

(D) Myanmar

13. Which of the following countries is not a Member of SAARC ?

(A) Bhutan

(B) Bangladesh

(C) Singapore

(D) Sri Lanka

Techofworld.In

Join Us-

Download Tech Of World App WtsApp/Call- 8596976190

14. The 15th 'World Forestry Congress' was held at _____.

(A) Seoul, Korea

(B) Durban, South Africa

(C) Jakarta, Indonesia

(D) Buenos Aires, Argentina

15. 'South Asia Economic Focus' a bi-annual Economic Report is published by _____.

(A) Asian Development Bank

(B) IMF

(C) World Bank

✓ (D) World Economic Forum

16. 'Minamata Convention' is an international platform to discuss about _____.

(A) Mercury Pollution

(B) Air Pollution

(C) Soil Pollution

(D) Silicon Pollution

17. Which of the following statements is not correct ?

(A) Ukraine is the fourth largest country in Europe after Russia

(B) Kyiv is the largest city in Ukraine

(C) It shares it's borders with Russia to East and Northest borders

✓ (D) It has coastline along the sea of Azov

18. According to 'Charitable Aid Foundation' which country topped 'World Giving Index, 2021' ?

(A) Kenya

(B) India

(C) Indonesia

(D) New Zeeland

19. With which American Scientist Professor Deepak Dhar shared the prestigious Boltzmann medal in Statistical Physics for the Year 2022 ?

(A) John Hopfield

(B) Kenneth G. Wilson

(C) Sam F. Edwards

(D) Dan Frenkal

Techofworld.In

Join Us-

Download Tech Of World App WtsApp/Call- 8596976190

20. 'Dharma Guardian Military Exercise' is conducted between which of the following countries ?

(A) India and Bhutan

(B) India and USA

(C) India and Japan

(D) India and France

21. Which of the following is not a matched pair ?

(A) Gulab Singh / Jammu

(B) Duleep Singh / Punjab

(C) Shah Shuja / Rohilkhand

(D) Wajid Ali Shah / Awadh

22. Which is not the matched pair ?

(A) Krishnaraja Wodeyar / Mysore

(B) Nizamulmulk Asaf Jah / Hyderabad

(C) Govinda Chandra / Cachar

(D) Zaman Shah / Peshawar

23. Clause 43, of the Charter Act of 1813 of the British Parliament concerned :

(A) Law and Order situation in India

(B) Education in India

(C) Foreign policy and trade relations in India

(D) Initiation of Indian Renaissance

24. For colonial times in India, which of the following sequence is in proper order – from the lowest to the highest ?

(A) Munsif's Court, Sadr Amin's Court, Zilla Court, Sadr Diwani Adalat

(B) Sadr Diwani Adalat, Munsif's Court, Zilla Court, Sadr Amin's Court

(C) Munsif's Court, Zilla Court, Sadr Amin's Court, Sadr Diwani Adalat

(D) Sadr Diwani Adalat, Sadr Amin's Court, Zilla Court, Munsif's Court

25. Bhangi was a clan that ruled over a part of :

(A) Dakhan

(B) Rohilkhand

(C) Kaveri Delta

(D) Punjab

26. "ekam sat, vipraha bahudha vadanti" comes from the :

(A) Mahabharata

(B) Ramayana

(C) Vedas

(D) Brahmanas

Techofworld.In

Join Us-

Download Tech Of World App WtsApp/Call- 8596976190

27. Deindustrialisation was the result of :

(A) An effort by the colonial rulers to destroy India's economy

(B) India's industry not being able to adjust to modern industrial production

(C) Lack of scientific and technical education in India

(D) India not having easy access to petroleum sources

28. Which of the combination is correct ?

(A) Mohandas Karamchand Gandhi was the editor of the Pratap ; Vinayak Damodar Savarkar founded the National Herald ; Jawaharlal Nehru founded the Free India Society ; Madan Mohan Malviya was the Chairman of the Hindustan Times ; Ganesh Shankar Vidyarthi worte the Hind Swaraj.

(B) Mohandas Karamchand Gandhi wrote the Hind Swaraj ; Vinayak Damodar Savarkar founded the Free India Society ; Jawaharlal Nehru founded the National Herald ; Madan Mohan Malviya was the Chairman of the Hindustan Times ; Ganesh Shankar Vidyarthi was the editor of the Pratap

(C) Mohandas Karamchand Gandhi wrote the Hind Swaraj ; Vinayak Damodar Savarkar founded the Free India Society ; Jawaharlal Nehru founded the National Herald ; Madan Mohan Malviya was the editor of the Pratap ; Ganesh Shankar Vidyarthi was the Chairman of the Hindustan Times.

(D) Mohandas Karamchand Gandhi wrote the Hind Swaraj ; Vinayak Damodar Savarkar was the editor of the Pratap ; Jawaharlal Nehru founded the National Herald ; Madan Mohan Malviya was the Chairman of the Hindustan Times ; Ganesh Shankar Vidyarthi founded the Free India Society

Techofworld.In

Join Us-

Download Tech Of World App WtsApp/Call- 8596976190

29. Which ruler was known as 'but shikan' ?

(A) Alauddin Khalji

(B) Sikandar Shah Miri

(C) Sikandar Lodhi

(D) Aurangzeb

30. The five principles of Panchsheel are substantially a reiteration of :

(A) The UN Charter

(B) The Charter of the League of Nations

(C) The Treaty of Berlin

(D) The Protocols of Zion

31. From which Constitution, Indian Constitution borrowed the provision of Single Citizenship ?

(A) Australia

(B) Canada

(C) USSR

(D) British

32. Who / which among the following has been given the power by the Constitution of India to impose 'Reasonable Restrictions' on the Fundamental Rights ?

(A) President of India

(B) Parliament

(C) Supreme Court

(D) High Courts

33. Article 21A refers to :

(A) Right to Freedom

(B) Right to Religion

(C) Right to Education

(D) Right Against Exploitation

34. Which of the Rights deals with Right to Vote and to be elected in India ?

(A) Fundamental Rights

(B) Natural Rights

(C) Constitutional Right

(D) Legal Right

Techofworld.In

Join Us-

Download Tech Of World App WtsApp/Call- 8596976190

35. Who / Which of the following can abolish a State Legislative Council ?

(A) Parliament

(B) Governor

(C) President

(D) State Assembly

36. Which of the following Articles of the Constitution of India refers to proportional Representation by means of the single transferable vote ?

(A) Article 53

(B) Article 54

(C) Article 54A

(D) Article 55(3)

37. In which year did the Constitution (99th) Amendment Act come into force ?

(A) 2013

(B) 2014

(C) 2015

(D) 2016

38. Which of the following statements is not correct ?

(A) The Chairman of the UPSC shall be ineligible for further employment under the Government of India or of any State

(B) A member of the UPSC is eligible for appointment as Chairman of the UPSC or Chairman of any State Commission

(C) The Chairman of a State Commission shall be eligible for appointment as a member or Chairman of the UPSC or as Chairman of any other State Commission

(D) A member of the State Commission will be eligible for any other employment under the Government of India or of a State

Techofworld.In

Join Us-

Download Tech Of World App WtsApp/Call- 8596976190

39. Which of the following Amendments has repealed Articles 19(1) (F) and 31 ?

(A) 42nd Amendment

(B) 43rd Amendment

(C) 44th Amendment

(D) 73rd Amendment

40. Who among the following appoints Comptroller and Auditor General of India ?

(A) President

(B) Prime Minister

(C) Chief Justice of the Supreme Court

(D) Finance Minister of India

41. Which of the following has submitted 'Right to Information : Master key to Good Governance' report ?

(A) Sarkaria Commission

(B) Punchhi Commission

(C) Administrative Reforms Commission – 1

(D) Administrative Reforms Commission – 2

42. Which of the following commissions has identified 27 modes of curruption ?

(A) Vohra Committee

(B) Central Vigilance Commission

(C) Santhanam Committee

(D) Sarkaria Commission

43. How many members are in Finance Commission ?

(A) A chairman and two other members

(B) A chairman and three other members

(C) A chairman and four other members

(D) A chairman and five other members

Techofworld.In

Join Us-

Download Tech Of World App WtsApp/Call- 8596976190

44. Which of the following is the most effective means of citizen's control over administration ?

(A) Public Opinion

(B) Election

(C) Pressure groups

(D) Advisory Committee

45. How can a new All India Service be created ?

(A) By a resolution of the Rajya Sabha

(B) By an order of the President

(C) By a resolution of the UPSC

(D) By an act of the Parliament

46. Which of the following committees laid down the British concept of Civil Service neutrality ?

(A) Fulton Committee

(B) Masterman Committee

(C) Sapru Committee

(D) Northcote – Trevelyn Committee

47. In which of the Five Year Plans in India, the concept of financial inclusion was included for the first time ?

(A) 8th

(B) 9th

(C) 10th

(D) 11th

48. Which of the following is accountable for the assessment of poverty ?

(A) HRD Ministry

(B) Ministry of Defence

(C) NITI Aayog

(D) Home Ministry

49. Who among the following had adopted the strategy of 'Rolling Plan' ?

(A) Jawaharlal Nehru

(B) Rajiv Gandhi

(C) Narendra Modi

(D) Morarji Desai

Techofworld.In

Join Us-

Download Tech Of World App WtsApp/Call- 8596976190

50. Which of the lists contains Economic Planning as a subject ?

(A) Concurrent List

(B) State List

(C) Union List

(D) Special List

51. Who is the first Chairperson of the National Human Rights Commission ?

(A) Justice Ranganath Mishra

(B) Justice M. N. Venkatachalliah

(C) Justice J. S. Verma

(D) Justice K. G. Balakrishnan

52. Where is the Head-quarter of the International Solar Alliance ?

(A) Gurugram

(B) Paris

(C) Leon

(D) London

53. Which country hosted the virtual mode of the Summit meeting of 20th Shanghai Cooperation Organisation (SCO) in November, 2021 ?

(A) China

(B) Russia

(C) India

(D) Kazakhstan

54. What are the total membership countries of NATO ?

(A) 29

(B) 30

(C) 33

(D) 35

55. Where is the head-quarter of the NATO ?

(A) London

(B) Madrid

(C) Brussels

(D) Istanbul

Techofworld.In

Join Us-

Download Tech Of World App WtsApp/Call- 8596976190

56. Which country hosted the firth Summit meeting of BIMSTEC in virtual mode in March, 2022 ?

(A) India

(B) Sri Lanka

(C) Bangladesh

(D) Myanmar

57. Which among the following countries was elected to the UN Security Council as a Non-permanent member in June 2022 ?

(A) Mozambique

(B) South Korea

(C) Canada

(D) Peru

58. How many years does a non-permanent member serve in the UN Security Council ?

(A) One year

(B) Two years

(C) Three years

(D) Five years

59. Which organization vision is to enable 'One World, One Sun, One Grid' ?

(A) Ministry of New and Renewable Energy

(B) Power Grid Corporation of India Ltd.

(C) International Solar Alliance

(D) Inter-governmental Panel on Climate Change

60. With which is the principle of 'Common But Differentiated Responsibilities' associated ?

(A) Paris Agreement on Climate Change

(B) BRICS Summit 2022

(C) NATO

(D) International Solar Alliance

Techofworld.In

Join Us-

Download Tech Of World App WtsApp/Call- 8596976190

61. Which one of the following options are not correctly matched with respect to the name of plates and the type of plate boundary ?

(A) The North American plate and Eurasian plate are diverging plates

(B) The Nazca plate and South American plates are diverging plates

(C) The Nazca plate and Pacific plates are exhibiting diverging plate boundary

(D) Indian-Australian plate and Eurasian plate are converging plates

62. Which one of the following ocean current is found in southern hemisphere ?

(A) Oyashio Current

(B) West Wind Drift

(C) Gulf Stream

(D) Canaries Current

63. Which one of the following is not correctly matched ?

(A) Prairies → North America

(B) Pampas → North America

(C) Veldt → South Africa

(D) Steppes → European Russia

64. Match List – I with List – II and select the correct answer using the code given below :

List – I (Type of Mountain)	List – II (Example)
(a) Block-mountain	(i) Himalayas
(b) Old folded mountain	(ii) Black-forest
(c) Relict mountain	(iii) Scottish Highlands
(d) Young folded mountain	(iv) Appalachian

Code :

	(a)	(b)	(c)	(d)
(A)	(iii)	(i)	(ii)	(iv)
(B)	(iii)	(i)	(iv)	(ii)
(C)	(ii)	(iv)	(iii)	(i)
(D)	(ii)	(iv)	(i)	(iii)

Techofworld.In

Join Us-

Download Tech Of World App WtsApp/Call- 8596976190

65. Which one of the following regions has the largest number of active volcanoes ?

(A) Alaska

(B) Aleutian Islands

(C) Hawaii Islands

(D) Iceland

66. Which one of the following rivers has a "bird-foot" delta ?

(A) Danube

(B) Mississippi

(C) Niger

(D) Nile

67. Which one of the following is not correctly matched ?

(A) Khamsin → North Africa and Arabia

(B) Bora → Adriatic coast

(C) Mistral → France

(D) Samoo → America

68. Match List – I with List – II and select the correct answer using the code given below :

List – I (Tropical Cyclone)	List – II (Region/Country)
(a) Baigio	(i) China
(b) Cyclone	(ii) Philippines
(c) Hurricane	(iii) Madagascar
(d) Typhoon	(iv) USA

Code :

	(a)	(b)	(c)	(d)
(A)	(ii)	(iii)	(i)	(iv)
(B)	(ii)	(iii)	(iv)	(i)
(C)	(iii)	(iv)	(i)	(ii)
(D)	(iii)	(iv)	(ii)	(i)

Techofworld.In

Join Us-

Download Tech Of World App WtsApp/Call- 8596976190

69. Match List – I with List – II and select the correct answer using the code given below :

List – I (Koppen's Symbol)	List – II (Climate)
(a) BWk	(i) Cold Mid-latitude steppe
(b) BWh	(ii) Hot Mid-latitude steppe
(c) BSh	(iii) Hot low latitude desert
(d) BSk	(iv) Cold low latitude desert

Code :

	(a)	(b)	(c)	(d)
(A)	(iv)	(iii)	(ii)	(i)
(B)	(iv)	(ii)	(iii)	(i)
(C)	(i)	(iii)	(ii)	(iv)
(D)	(i)	(ii)	(iii)	(iv)

70. The widest continental shelf is found in the :

(A) Arctic ocean

(B) Atlantic ocean

(C) Indian ocean

(D) Pacific ocean

71. Which one of the following geosynclines is the oldest ?

(A) Delhi geosyncline

(B) Dharwar geosyncline

(C) Eastern Ghat geosyncline

(D) Satpura geosyncline

72. Which one of the following rivers does not originate from the Maikal Range ?

(A) Tapi

(B) Son

(C) Narmada

(D) Mahanadi

73. Which category of the following forests occupy the largest percentage in India ?

(A) Conifers and pines

(B) Equatorial evergreen

(C) Tropical deciduous

(D) Desert vegetation

Techofworld.In

Join Us-

Download Tech Of World App WtsApp/Call- 8596976190

74. Consider the following statements and select the correct answer using the code given below :

(i) The Gujarat Plain was formed by the depositional work of parallel consequent rivers

(ii) The Gujarat Plain contains the Cretaceous lava formations

Code :

(A) Only (i) is correct

(B) Only (ii) is correct

(C) Both (i) and (ii) are correct

(D) Neither (i) nor (ii) is correct

75. Who among the following scholars did not delineate 'the climatic regions of India' ?

(A) Blandford, H. E.

(B) Coppack, J.

(C) Spate, O. H. K.

(D) Singh, R. L.

76. Arrange the rivers in ascending order of their contribution to the formation of coastal plains :

(A) The Mahanadi > the Brahmani > the Baitarini > the Rushikulya > the Subarnarekha

(B) The Mahanadi > the Baitarini > the Brahmani > the Subarnarekha > the Rushikulya

(C) The Mahanadi > the Rushikulya > the Brahmani > the Baitarini > the Subarnarekha

(D) The Mahanadi > the Brahmani > the Baitarini > the Subarnarekha > the Rushikulya

Techofworld.In

Join Us-

Download Tech Of World App WtsApp/Call- 8596976190

77. Match the morphological units of Rolling uplands (List – I) with the correct river basin (List – II).

List – I (Morphological Units)	List – II (Basin Associated)
(a) The Rajgangpur – Panposh Uplands	(i) Ib Basin.
(b) The Jharsuguda Uplands	(ii) Northern Tel Basin
(c) The Balangir Titlagarh-Patnagarh Uplands	(iii) The Sabari Basin
(d) The Malakanagiri Uplands	(iv) Koel and the Sankh Rivers

Code :

	(a)	(b)	(c)	(d)
(A)	(iv)	(i)	(ii)	(iii)
(B)	(i)	(ii)	(iii)	(iv)
(C)	(iii)	(ii)	(i)	(iv)
(D)	(ii)	(iii)	(i)	(iv)

78. **Ranga Mati** and **Rugidia soil** belongs to which primary soil group in Odisha ?

(A) Regur Soil

(B) Laterite Soil

(C) The Brown Forest Earth

(D) Yellow Earth

79. Which of the following factor is responsible for fluctuation in Monsoon in India ?

(A) If 2nd equatorial trough does not merge with ITCZ

(B) Southern Branch of South West Tropical Jet re-establish over Northern India

(C) Late disappearance of Southern Branch of Subtropical Westerly jet stream from Northern India

(D) Development of Strong Low Pressure cell over Tibetan Landmass

Techofworld.In

Join Us-

Download Tech Of World App WtsApp/Call- 8596976190

80. Among the following options which mountain pass doesn't belongs to the correct state :

(A) Bara Lacha la Pass → Himachal Pradesh

(B) Mana Pass → Uttarakhand

(C) Jelep La → Arunachal Pradesh

(D) Nathu La → Sikkim

81. The Indian National Defence University (INDU) is located at :

(A) Dehradun

(B) New Delhi

(C) Binola Village, Haryana

(D) Chennai

82. The present Chief of Air Staff of India is :

(A) MM Naravane

(B) V. R. Chaudhari

(C) Bipin Rawat

(D) Hari Kumar

83. QUAD comprises of the following countries :

(A) USA, UK, Japan and India

(B) Russia, UK, France, India and Australia

(C) USA, India, Japan and Australia

(D) UK, Japan, India and Australia

84. Who is known as the 'Missile Woman of India' ?

(A) Dr. Tessy Thomas

(B) Indira Gandhi

(C) Gunjan Saxena

(D) Mary Kom

85. On 28 January, 2022, which helicopter was officially inducted into Indian Naval Ship (INS) Utkrosh at Port Blair :

(A) ALH Mk III

(B) MI-24

(C) CH-47 Chinook

(D) AH-64 Apache

Techofworld.in

Join Us-

Download Tech Of World App WtsApp/Call- 8596976190

86. The only Air Force Officer to have received the Param Vir Chakra is :

(A) Air Commodore Ravish Malhotra

(B) Flying Officer Nirmal Jit Singh Sekhon

(C) Sqn. Ldr. Abhinandan Varthaman

(D) Wing Commander Rakesh Sharma

87. The S-400 Missile Defence System is procured by India from :

(A) France

(B) Russia

(C) USA

(D) Israel

88. In a boost to Atmanirbhar Bharat, which aircraft is was given Acceptance of Necessity by the Defence Acquisition Council in June 2022, to be manufactured by HAL ?

(A) Rafael

(B) Mirage 2000

(C) Dornier

(D) SU – 30

89. In January 2022, the Border Roads Organisation carried out the final blast on Sela Tunnel. The tunnel is located in :

(A) Meghalaya

(B) Manipur

(C) Ladakh

(D) Arunachal Pradesh

90. The equivalent rank of a Squadron Leader in the Army is :

(A) Major

(B) Brigadier

(C) Captain

(D) Subedar Major

91. Who were awarded Nobel Prize in Chemistry in 2019 for developing lithium-ion batteries ?

(A) Benjamin List and David MacMillan

(B) Emmanuelle Charpentier and Jennifer A. Doudna

(C) Roger Penrose, Reinhard Genzel and Andrea Ghez

(D) John B. Goodenough, M. Stanley Whittingham and Akira Yoshino

Techofworld.in

Join Us-

Download Tech Of World App WtsApp/Call- 8596976190

92. Which recent online campaign led to declaration of Jaypore Rainforest as National Park in Assam ?

(A) Siang Bachao Andolan

(B) Takam Mishing Porin Kebang

(C) Save Dehing Patkai

(D) None of these

93. Which of the following is not a greenhouse gas ?

(A) O_3

(B) N_2O

(C) NO_2

(D) CFCs

94. Who developed the concept of hotspots ?

(A) Stuart L. Pimm

(B) Edward J. Laurent

(C) John Muir

(D) Norman Myers

95. What are parasitic, photosynthetic plants called ?

(A) Semiparasites

(B) Hemiparasites

(C) Microparasites

(D) Holoparasites

96. How frequently pollutants are being monitored under National Air Quality Monitoring Programme [NAMP] ?

(A) Once in a week

(B) Twice in a week

(C) Alternate days

(D) Once in a fortnight

97. What is the total species deversity across all communities within a geographic area called ?

(A) Alpha diversity

(B) Beta diversity

(C) Gamma diversity

(D) Delta diversity

98. Which is the world's largest Solar Park ?

(A) Benban Solar Park, Egypt

(B) Bhadla Solar Park, India

(C) Huanghe Hydropower Hainan Solar Park, China

(D) Noor Abu Dhabi, United Arab Emirate

Techofworld.In

Join Us-

Download Tech Of World App WtsApp/Call- 8596976190

99. What is the modeling approach for evaluating the response of individual species to climate change called ?

(A) Zero dimension model

(B) Box model

(C) General circulation model

(D) Bioclimatic envelope model

100. Which of the following have high assimilation efficiencies of over 90 percent ?

(A) Secondary carnivores

(B) Herbivores

(C) Predatory spiders

(D) Social insects

Techofworld.In

Techofworld.In

Join Us-

OPSC Exam- Mock Test, PYQS,Note, E-Books Get Now OnApp

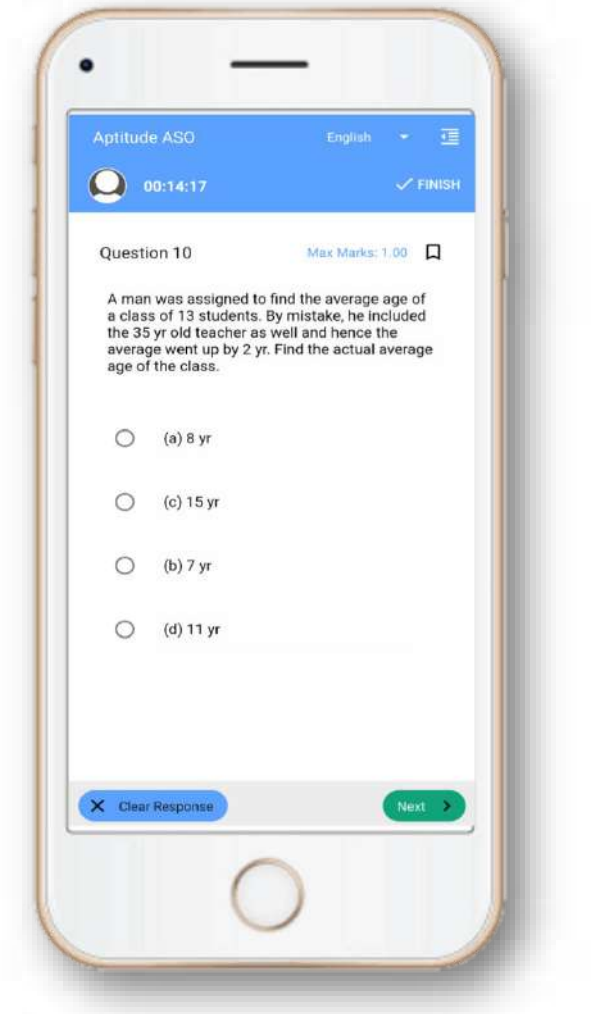

Tech Of World

Download App

GET IT ON Google Play

Click Here

YouTube- Click Here

Telegram- Click Here

Facebook- Click Here

Download Tech Of World App WtsApp/Call- 8596976190

DO NOT OPEN THIS TEST BOOKLET UNTIL YOU ARE ASKED TO DO SO

Test Booklet Series

A

TEST BOOKLET

RECRUITMENT OF A. S. O.

(A) ENGLISH LANGUAGE

(B) ODIA LANGUAGE

T. B. C. : ASG – 3/21

Sl. No. 629005

Time Allowed : 2 Hours

Techofworld.In

Maximum Marks : 200

: INSTRUCTIONS TO CANDIDATES :

1. IMMEDIATELY AFTER THE COMMENCEMENT OF THE EXAMINATION, YOU SHOULD CHECK THAT THIS TEST BOOKLET DOES NOT HAVE ANY UNPRINTED OR TORN OR MISSING PAGES OR ITEMS ETC. IF SO, GET IT REPLACED BY A COMPLETE TEST BOOKLET OF THE SAME SERIES ISSUED TO YOU.
2. ENCODE CLEARLY THE TEST BOOKLET SERIES A, B, C OR D, AS THE CASE MAY BE, IN THE APPROPRIATE PLACE IN THE ANSWER SHEET USING BALL POINT PEN (BLUE OR BLACK).
3. You have to enter your **Roll No.** on the Test Booklet in the Box provided alongside. DO NOT write *anything else* on the Test Booklet.

Techofworld.In

4. YOU ARE REQUIRED TO FILL UP & DARKEN ROLL NO., TEST BOOKLET / QUESTION BOOKLET SERIES IN THE ANSWER SHEET AS WELL AS FILL UP TEST BOOKLET / QUESTION BOOKLET SERIES AND SERIAL NO. AND ANSWER SHEET SERIAL NO. IN THE ATTENDANCE SHEET CAREFULLY. WRONGLY FILLED UP ANSWER SHEETS ARE LIABLE FOR REJECTION AT THE RISK OF THE CANDIDATE.
5. This Test Booklet contains **200** items (questions). i.e. Sl. No. **1** to **100** items (questions) for **English Language** and Sl. No. **101** to **200** items (questions) for **Odia Language**. Each item (question) comprises four responses (answers). You have to select the correct response (answer) which you want to mark (darken) on the Answer Sheet. In case, you feel that there is more than one correct response (answer) you should mark (darken) the response (answer) which you consider the best. In any case, choose **ONLY ONE** response (answer) for each item (question).
6. You have to mark (darken) all your responses (answers) **ONLY** on the **separate Answer Sheet** provided, by **using BALL POINT PEN (BLUE OR BLACK)**. See instructions in the Answer Sheet.
7. (i) All items (questions) carry equal marks. All items (questions) are compulsory. Your total marks will depend only on the number of correct responses (answers) marked by you in the Answer Sheet.

   (ii) There will be negative markings for wrong responses (answers). 25 (Twenty five) percentage of marks allotted to a particular item (question) will be deducted as negative marking for every wrong response (answer).

   (iii) If candidate give more than one response (answer), it will be treated as a wrong response (answer) even if one of the given responses (answers) happens to be correct and there will be same penalty as above to that item (question).
8. Before you proceed to mark (darken) in the Answer Sheet the responses (answers) to various items (questions) in the Test Booklet, you have to fill in some particulars in the Answer Sheet as per the instructions sent to you with your **Admission Certificate**.
9. After you have completed filling in all your responses (answers) on the Answer Sheet and after conclusion of the examination, you should hand over to the Invigilator the *Answer Sheet* issued to you. You are allowed to take with you the candidate's copy / second page of the Answer Sheet along with the **Test Booklet**, after completion of the examination, for your reference.
10. Sheets for rough work are appended in the Test Booklet at the end.

DO NOT OPEN THIS TEST BOOKLET UNTIL YOU ARE ASKED TO DO SO

Join Us-

Download Tech Of World App WtsApp/Call- 8596976190

(A) ENGLISH LANGUAGE

1. Change the active voice into passive voice : I will clean the house every Saturday. The house _____ by me every Saturday.
   (A) cleaned
   (B) will cleaned
   (C) will be cleaned
   (D) None of these

2. People _____ walk on grass.
   (A) couldn't
   (B) needn't
   (C) mustn't
   (D) may not

3. Choose the correct word order :
   (A) Why she did leave so early ?
   (B) Why did she leave so early ?
   (C) Why did so early she leave ?
   (D) Why so early did she leave ?

4. Select same meaning of the underlined word : Take care not to get hurt with the steam from the Kettle.
   (A) Burnt
   (B) Bruised
   (C) Scalded
   (D) Cut

5. _____ his principles, he has to be very careful.
   (A) With regard of
   (B) With regard on
   (C) With regard to
   (D) None of these

6. He was seen _____ to the school.
   (A) went
   (B) going
   (C) gone
   (D) go

7. They organized a party _____ his honour. That Ajita was not invited _____ it, was a shame. She admired him most and it seems unlikely that she would forgive the organizers _____ their omission.
   (A) at, for, towards
   (B) about, at, against
   (C) in, to, for
   (D) after, on, with

8. When I say that the benefits of demonetization are moot, what do I mean ?
   (A) That I do not understand what the benefits are.
   (B) That I do not understand what demonetization is.
   (C) That the benefits of demonetization are surely seen.
   (D) That the benefits of demonetization are debatable.

Techofworld.In

Join Us-

Download Tech Of World App WtsApp/Call- 8596976190

9. Choose matching prepositions to complete the following phrases :

(I) According _____ (i) of the source ...

(II) Different _____ (ii) to the first draft ...

(III) Based _____ (iii) by this information ...

(IV) Bored _____ (iv) from the events ...

(V) Consisting _____ (v) on cards ...

According to the code, the correctly matched pairs would be :

(A) I – (ii), II – (iv), III – (v), IV – (iii), V – (i)

(B) I – (i), II – (ii), III – (iii), IV – (v), V – (iv)

(C) I – (v), II – (iii), III – (i), IV – (ii), V – (iv)

(D) I – (ii), II – (v), III – (i), IV – (iii), V – (iv)

10. He had earned his well-paid job after a long struggle, but when he laughed at the most inopportune time, it cost him the job.

List the verbs in this sentence :

(A) earned, struggle, laughed

(B) had earned, laughed, cost

(C) struggle, laughed, cost

(D) job, laughed, inopportune

11. Which of the statements about the following sentence is TRUE ?

The Raos had been living so frugally all year that they saved enough money for a Mercedes.

(A) The present perfect continuous tense used here indicates a state that continues into the present.

(B) The past perfect continuous tense used here indicates an ongoing state prior to a past action.

(C) The perfect tense used here is not clear enough to justify the state indicated in the present.

(D) The past perfect tense used here does not indicate an ongoing state prior to a past action.

12. Choose from the options how the sentence can be improved :

They could not admire his bright performance because of they dislike him.

(A) because of their disliking of him

(B) because of their dislike him

(C) because they dislike him

(D) No correction required

Techofworld.in

Join Us-

Download Tech Of World App WtsApp/Call- 8596976190

13. Choose from the options how the sentence can be improved :

She was uneasy because she never be on a plane before.

(A) had never been
(B) never been
(C) is never been
(D) No improvement

14. Choose from the options how the sentence can be improved :

They only work when they have no money.

(A) When they have no money, they only work
(B) they only work
(C) work only when
(D) No improvement

15. Choose from the options how the sentence can be improved :

I. T. experts may have to stop hunting for better job opportunities as these are not so easily available now.

(A) No correction required
(B) may be stopping the hunting
(C) should have to stop hunt
(D) might have to stop hunting

16. Choose from the options how the sentence can be improved :

The NYC building at New York City is as high as every other building in the United States of America.

(A) high than every other building
(B) as high as every other building
(C) higher than any other building
(D) No improvement

17. Choose the correct part of speech for the words in bracket :

She (as well as) her sister is engaged.

(A) Conjunction
(B) Preposition
(C) Adjective
(D) Adverb

18. Choose the correct part of speech for the word in bracket :

This politician is notorious (for) corruption.

(A) Conjunction
(B) Preposition
(C) Adjective
(D) Adverb

19. Choose the correct part of speech for the word in bracket :

This golden ring is too (costly) to purchase.

(A) Conjunction
(B) Preposition
(C) Adjective
(D) Adverb

Techofworld.In

Join Us-

Download Tech Of World App WtsApp/Call- 8596976190

20. Choose the correct part of speech for the word in bracket :

A(drowning) man catches at a straw.

(A) Complement

(B) Infinitive

(C) Gerund

(D) Participle

21. Choose the correct part of speech for the word in bracket :

A great talker is a great (liar).

(A) Article

(B) Verb

(C) Pronoun

(D) Noun

22. Choose the correct part of speech for the words in bracket :

Eat (to live), but do not live to eat.

(A) Complement

(B) Infinitive

(C) Gerund

(D) Participle

23. Anita _____ for the charitable cause.

(A) come to contributed

(B) came to contributed

(C) came to contribute

(D) comes to contributed

24. Everyone at the party _____ amazed by his performance.

(A) was

(B) were

(C) are

(D) can

25. Alice is not at home at the moment. She _____ work.

(A) was on

(B) was at

(C) is on

(D) is at

26. French people love cooking, _____ the English don't seem very interested.

(A) when

(B) whenever

(C) where

(D) whereas

27. Choose the correct statement :

(A) My aunt who lives in Mumbai is a doctor.

(B) My aunt, who lives in Mumbai, is a doctor.

(C) My aunt, who lives in Mumbai is a doctor.

(D) My aunt who lives in Mumbai, is a doctor.

Techofworld.In

Join Us-

Download Tech Of World App WtsApp/Call- 8596976190

28. Wait a minute, I _____ this box for you.

(A) carr·
(B) will carry
(C) carried
(D) was carrying

29. It's wet and rainy outside today. You _____ go out without an umbrella.

(A) shouldn't
(B) won't
(C) don't have to
(D) should

30. Change into passive : The salt-water corroded the metal beams. The metal beams _____ by the salt-water.

(A) was corroded
(B) corroded
(C) has corroded
(D) were corroded

31. The headmaster _____ to talk to you.

(A) want
(B) wants
(C) has wanted
(D) None of these

32. A bomb scare _____ a delay of the flight.

(A) causing
(B) cause
(C) was caused
(D) had caused

33. Change into passive : Everyone understands English. English _____ by everyone.

(A) is understood
(B) has been understood
(C) was understood
(D) had understood

34. The diamond ring that her husband bought for her turned _____ to be fake one.

(A) in
(B) of
(C) out
(D) None of these

35. Tom _____ to call Susan yesterday but he has forgotten.

(A) is supposed
(B) supposed
(C) supposes
(D) was supposed

Techofworld.In

Join Us-

Download Tech Of World App WtsApp/Call- 8596976190

36. Choose the correct statement :

(A) She is senior than me.

(B) She is senior to me.

(C) She is senior then me.

(D) None of these

37. Choose the correct statement :

(A) I will inform this them.

(B) I will inform them of this.

(C) I will inform this to them.

(D) I will inform them with this.

38. Which sentence is correct ?

(A) She lives in an apartment.

(B) She lives to an apartment.

(C) She lives on an apartment.

(D) She live in apartment.

39. Which sentence is correct ?

(A) We'll go shopping soon.

(B) We'll go a shopping soon.

(C) We'll go to shopping soon.

(D) We will shopping soon.

40. Which sentence is correct ?

(A) I'm tired of working.

(B) I am tired to working.

(C) I'm tiring of working.

(D) I'm tired and working.

41. Doesn't it (intrigue) you.

The word in the bracket means :

(A) Arouse interest

(B) Pleases

(C) Offends

(D) Tiredness

42. The branches of trees were (fondling) the sky.

The word in bracket means :

(A) Moving

(B) Leaning

(C) Touching

(D) Reaching

43. What is the synonym of "veracity" ?

(A) Inaccuracy

(B) Reality

(C) Redundancy

(D) Falsehood

44. Give the antonym of MILITARY :

(A) Civil

(B) Militant

(C) Civility

(D) Coup

Techofworld.In

Join Us-

Download Tech Of World App WtsApp/Call- 8596976190

45. Choose the word which is most opposite in meaning to the word EMBRACE :

(A) Disobey

(B) Contradict

(C) Reject

(D) Obscure

46. Choose the word which is most opposite in meaning to the word SUBVERSION :

(A) Destabilisation

(B) Clarity

(C) Compliance

(D) Sanity

47. Choose the word which is most opposite in meaning to the word SINISTER :

(A) Good

(B) Evil

(C) Long

(D) Short

48. She wasn't feeling well, so she was _____ to go to the evening party. What word should be used to fill in the blank ?

(A) reliant

(B) reluctant

(C) relinquished

(D) resistance

49. He fired his assistant for accessing his files without his _____. What word is appropriate for the blank ?

(A) Consensus

(B) Contempt

(C) Consent

(D) Concede

Directions (Q. Nos. 50 – 52) : *In each of the following questions four words are given of which two are most nearly the same or opposite in meaning. Find the two words which are most nearly the same or opposite in meaning, from the below given combinations.*

50. (I) Withstand

(II) Climate

(III) Hot

(IV) Surrender

(A) (II) – (III)

(B) (I) – (IV)

(C) (III) – (IV)

(D) (I) – (II)

Techofworld.In

Join Us-

Download Tech Of World App WtsApp/Call- 8596976190

51. (I) Gregarious
(II) Quixotic
(III) Sociable
(IV) Discernible
(A) (I) – (III)
(B) (III) – (IV)
(C) (II) – (IV)
(D) (I) – (II)

52. (I) Jeopardise
(II) Repudiate
(III) Confuse
(IV) Disown
(A) (I) – (III)
(B) (III) – (IV)
(C) (II) – (IV)
(D) (I) – (II)

53. Nafeesa is afraid _____ spiders.
(A) from
(B) in
(C) about
(D) of

54. I am worried _____ the exam.
(A) in
(B) about
(C) on
(D) of

55. He looks upset, I think he took the criticism _____ heart.
(A) to
(B) about
(C) in
(D) of

56. I am envious _____ them.
(A) of
(B) about
(C) in
(D) on

57. He confided _____ me.
(A) about
(B) in
(C) on
(D) of

58. They decided _____ the grey sofa.
(A) about
(B) on
(C) in
(D) of

Techofworld.In

Join Us-

Download Tech Of World App WtsApp/Call- 8596976190

59. She suffers _____ a heart disease.
(A) about
(B) in
(C) from
(D) on

60. The teacher set some homework _____ the end of the lesson.
(A) about
(B) in
(C) of
(D) at

61. I am good _____ tennis.
(A) about
(B) in
(C) at
(D) of

62. We arrived _____ the station an hour late.
(A) about
(B) in
(C) at
(D) of

63. They usually spend their holidays in _____ mountains.
(A) the
(B) no article
(C) a
(D) an

64. Los Angeles has _____ ideal climate.
(A) the
(B) no article
(C) a
(D) an

65. This is _____ worst Mexican restaurant in the country.
(A) the
(B) no article
(C) a
(D) an

66. I can't live on _____ 500 dollars a month.
(A) the
(B) no article
(C) a
(D) an

67. Someone call _____ police-man !
(A) the
(B) no article
(C) a
(D) an

Techofworld.In

Join Us-

Download Tech Of World App WtsApp/Call- 8596976190

68. Someone call _____ police !

(A) the

(B) no article

(C) a

(D) an

69. He is _____ real American hero.

(A) the

(B) no article

(C) a

(D) an

70. I don't like _____ dogs, but I like my brother's dog.

(A) the

(B) no article

(C) a

(D) an

71. I haven't seen him in _____ five years.

(A) the

(B) no article

(C) a

(D) an

72. Kobe Bryant is _____ basketball player.

(A) the

(B) no article

(C) a

(D) an

73. The fire _____ the huts before the fire brigade came.

(A) had burnt

(B) will burn

(C) has burnt

(D) bums

74. I have _____ my work.

(A) do

(B) does

(C) will do

(D) done

75. Don't make a noise, she _____.

(A) sleep

(B) will sleep

(C) is sleeping

(D) None of these

76. Will you go _____ a movie ?

(A) to see

(B) seen

(C) to seeing

(D) None of these

Techofworld.In

Join Us-

Download Tech Of World App WtsApp/Call- 8596976190

77. You are required to rearrange these parts, which are labelled P, Q, R and S to produce the correct sentence :

(P) for thousands of years

(Q) famous symbols of ancient civilizations

(R) Monuments have been created

(S) and they are often the most durable and

(A) SRQP

(B) QPRS

(C) PRSQ

(D) RPSQ

78. You are required to rearrange these parts, which are labelled P, Q, R and S to produce the correct sentence :

(P) is one of the most widely used indicators

(Q) of ecosystems and their biodiversity

(R) for assessing the condition

(S) The conservation status of plants and animals

(A) SPRQ

(B) SRQP

(C) QRPS

(D) PQRS

79. You are required to rearrange these parts, which are labelled P, Q, R and S to produce the correct sentence :

(P) for a short time where a new, innovative, or much-improved product

(Q) The practice of price skimming

(R) is launched onto a market

(S) involves charging a relatively high price

(A) QSPR

(B) RSQP

(C) PRSQ

(D) RQSP

80. You are required to rearrange these parts, which are labelled P, Q, R and S to produce the correct sentence :

(P) by an emperor named Shah Jahan

(Q) The Taj Mahal is a

(R) in memory of his wife Mumtaz Mahal

(S) beautiful monument built in 1631

(A) QPRS

(B) QSRP

(C) PQRS

(D) QSPR

Techofworld.In

Join Us-

Download Tech Of World App WtsApp/Call- 8596976190

81. You are required to rearrange these parts, which are labelled P, Q, R and S to produce the correct sentence :

(P) was designed by the British architect George Wittet and

(Q) The Gateway of India

(R) in the year 1924

(S) was opened for general Public

(A) QSPR

(B) QPSR

(C) PQSR

(D) SRQP

82. Do you _____ these events ?

(A) likes

(B) like

(C) liking

(D) have like

83. The dog and the cat _____ been fed.

(A) has

(B) are

(C) were

(D) have

84. His works _____ appreciable.

(A) are

(B) is

(C) has

(D) have

85. Many a man _____ suffered during partition.

(A) have

(B) has

(C) were

(D) is

86. The chief along with his family _____ involved.

(A) are

(B) has

(C) is

(D) have

87. She shall _____ soon.

(A) come

(B) comes

(C) coming

(D) came

88. Measles _____ a common disease among children.

(A) are

(B) is

(C) were

(D) has

Techofworld.In

Join Us-

Download Tech Of World App WtsApp/Call- 8596976190

89. The board of directors _____ anxious.

(A) are

(B) have been

(C) has been

(D) were

90. Few applicants _____ backed out.

(A) have

(B) has

(C) were

(D) are

91. Some of the rice _____ still left.

(A) is

(B) are

(C) has

(D) have

92. Public speaking _____ a skill.

(A) are

(B) have

(C) has

(D) is

Directions (Q. Nos. 93 to 97) : *Read the following passage carefully and answer the questions that follow :*

A man is known by the book he reads as well as by the company he keeps ; for there is a companionship of books as well as of men and one should always live in the best company, whether it be of books or of man.

A good book may be among the best of friends. It is the same today that it always was, and it will never change. It is the most patient and cheerful of companions. It does not turn its back upon in times of adversity or distress. It always receives us with the same kindness ; amusing and interesting us in youth, comforting and consoling us in age.

93. Which of the following would be the most appropriate title for the given passage ?

(A) Books show the reader's character

(B) Books as man's abiding friends

(C) Books are useful in the youth

(D) The importance of books in old age

94. Which of the following is opposite in meaning to the word 'adversity' occurring in the passage ?

(A) Happiness

(B) Prosperity

(C) Progress

(D) Misfortune

Techofworld.In

Join Us-

Download Tech Of World App WtsApp/Call- 8596976190

95. The statement, "a good book may be among best of friends," in the passage means that :

(A) There cannot be a better friend than a good book

(B) Books may be good friends, but not better than good men

(C) A good book can be included among the best of friends of mankind

(D) Our best friends read the same good books

96. According to the passage, which of the following statements is not true ?

(A) Good books as well as good men always provide the finest company.

(B) A good book never betrays us.

(C) We have sometimes to be patient with a book as it may bore us.

(D) A good book serves as a permanent friend.

97. According to the passage, A man may usually be known by the books he reads because :

(A) His reading habits shows that he is a scholar

(B) The books he reads affect his thinking

(C) Books provide him a lot of knowledge

(D) His selection of books generally reveals his temperament and character

98. Glutton is related to Eat as Garrulous is related to _____.

(A) Walk

(B) Talk

(C) Laugh

(D) Travel

99. Dwell is related to Denizen as Inherit is related to _____.

(A) Acquire

(B) Successor

(C) Outcast

(D) Heir

100. Writer is related to Reader as Producer is related to _____.

(A) Seller

(B) Consumer

(C) Creator

(D) Contractor

Techofworld.in

Join Us-

OPSC Exam- Mock Test, PYQS,Note, E-Books Get Now OnApp

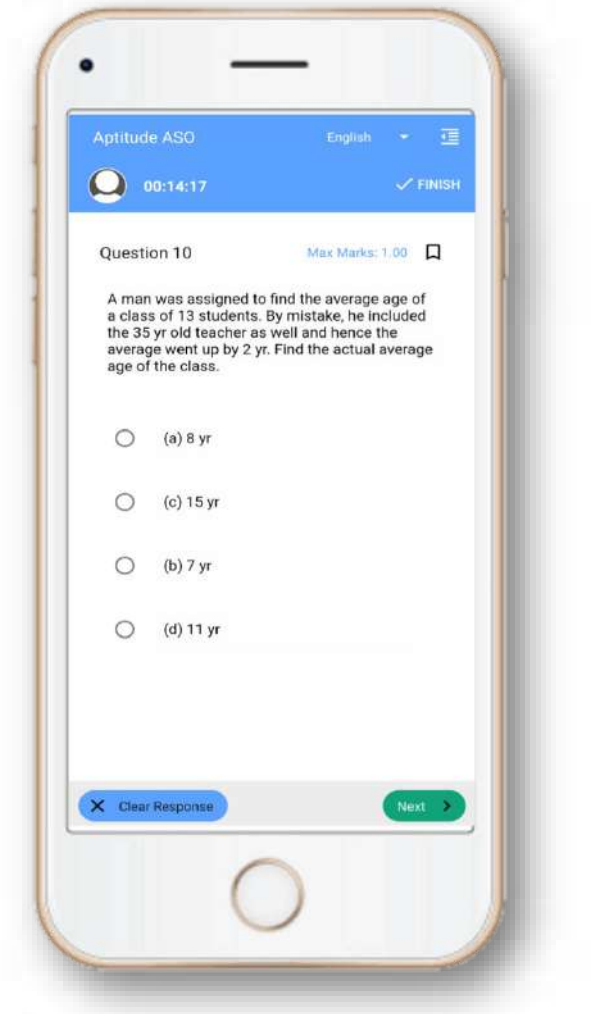

Tech Of World

Download App

GET IT ON Google Play

Click Here

YouTube- Click Here

Telegram- Click Here

Facebook- Click Here

Download Tech Of World App WtsApp/Call- 8596976190

DO NOT OPEN THIS TEST BOOKLET UNTIL YOU ARE ASKED TO DO SO

T. B. C. : ASG – 2/21

Test Booklet Series

A

TEST BOOKLET

RECRUITMENT OF A. S. O.

Sl. No. 405205

(A) TEST OF REASONING & MENTAL ABILITY

(B) MATHEMATICS

Time Allowed : 1½ Hours

Maximum Marks : 100

Techofworld.in

: INSTRUCTIONS TO CANDIDATES :

1. IMMEDIATELY AFTER THE COMMENCEMENT OF THE EXAMINATION, YOU SHOULD CHECK THAT THIS TEST BOOKLET **DOES NOT** HAVE ANY UNPRINTED OR TORN OR MISSING PAGES OR ITEMS ETC. IF SO, GET IT REPLACED BY A COMPLETE TEST BOOKLET OF THE SAME SERIES ISSUED TO YOU.
2. ENCODE CLEARLY THE TEST BOOKLET SERIES **A, B, C** OR **D**, AS THE CASE MAY BE, IN THE APPROPRIATE PLACE IN THE ANSWER SHEET USING BALL POINT PEN (BLUE OR BLACK).
3. You have to enter your **Roll No.** on the Test Booklet in the Box provided alongside. **DO NOT** write *anything else* on the Test Booklet. 675153

Techofworld.in

4. **YOU ARE REQUIRED TO FILL UP & DARKEN ROLL NO., TEST BOOKLET / QUESTION BOOKLET SERIES IN THE ANSWER SHEET AS WELL AS FILL UP TEST BOOKLET / QUESTION BOOKLET SERIES AND SERIAL NO. AND ANSWER SHEET SERIAL NO. IN THE ATTENDANCE SHEET CAREFULLY. WRONGLY FILLED UP ANSWER SHEETS ARE LIABLE FOR REJECTION AT THE RISK OF THE CANDIDATE.**
5. This Test Booklet contains **100** items (questions). i.e. Sl. No. **1** to **50** items (questions) for **Test of Reasoning & Mental Ability** and Sl. No. **51** to **100** items (questions) for **Mathematics**. Each item (question) comprises four responses (answers). You have to select the correct response (answer) which you want to mark (darken) on the Answer Sheet. In case, you feel that there is more than one correct response (answer). You should mark (darken) the response (answer) which you consider the best. In any case, choose **ONLY ONE** response (answer) for each item (question).
6. You have to mark (darken) all your responses (answers) **ONLY** on the **separate Answer Sheet** provided, by **using BALL POINT PEN (BLUE OR BLACK)**. See instructions in the Answer Sheet.
7. (i) All items (questions) carry equal marks. All items (questions) are compulsory. Your total marks will depend only on the number of correct responses (answers) marked by you in the Answer Sheet.

   (ii) There will be negative markings for wrong responses (answers). 25 (Twenty five) percentage of marks allotted to a particular item (question) will be deducted as negative marking for every wrong response (answer).

   (iii) If candidate give more than one response (answer), it will be treated as a wrong response (answer) even if one of the given responses (answers) happens to be correct and there will be same penalty as above to that item (question).
8. Before you proceed to mark (darken) in the Answer Sheet the responses (answers) to various items (questions) in the Test Booklet, you have to fill in some particulars in the Answer Sheet as per the instructions sent to you with your **Admission Certificate**.
9. After you have completed filling in all your responses (answers) on the Answer Sheet and after conclusion of the examination, you should hand over to the Invigilator the *Answer Sheet* issued to you. You are allowed to take with you the candidate's copy / second page of the Answer Sheet along with the **Test Booklet**, after completion of the examination, for your reference.
10. Sheets for rough work are appended in the Test Booklet at the end.

DO NOT OPEN THIS TEST BOOKLET UNTIL YOU ARE ASKED TO DO SO

Join Us-

Download Tech Of World App WtsApp/Call- 8596976190

(A) TEST OF REASONING & MENTAL ABILITY

1. Select the correct option that indicates the arrangement of the given words in the order in which they appear in a telephone directory :

(I) Krishanmurty

(II) Krishnamurthy

(III) Krishnmurthi

(IV) Krishanmurthy

(V) Krishnamurti

(A) (IV), (I), (II), (V), (III)

(B) (IV), (I), (II), (III), (V)

(C) (IV), (V), (II), (III), (I)

(D) (IV), (III), (V), (III), (II)

2. In a certain code language, 'VIRTUE' is coded as '201' and 'TRAGEDY' is coded as '218'. How will 'PROFANE' be coded in that language ?

(A) 570

(B) 342

(C) 432

(D) 456

Directions (Q. Nos. 3 to 5) : One hundred and twenty five cubes of the same size are arranged in the form of a cube on a table. Then a column of five cubes is removed from each of the four corners. All the exposed faces of the rest of the solid (except the face touching the table) are coloured red. Now, answer these questions based on the above statement :

3. How many small cubes are there in the solid after the removal of the columns ?

(A) 120

(B) 110

(C) 105

(D) 100

4. How many cubes do not have any coloured face ?

(A) 12

(B) 24

(C) 36

(D) 48

Techofworld.in

Join Us-

Download Tech Of World App WtsApp/Call- 8596976190

5. How many cubes have only one red face ?

(A) 40

(B) 25

(C) 20

(D) 15

6. David gets on the elevator at the 11th floor of a building and rides up at the rate of 57 floors per minute. At the same time, Albert gets on an elevator at the 51st floor of the same building and rides down at the rate of 63 floors per minute. If they continue travelling at these rates, then at which floor will their paths cross ?

(A) 19

(B) 28

(C) 30

(D) 37

7. An egg vendor calls on his first customer and sells half his eggs and half an egg. To the second customer, he sells half of what he has left with and half an egg, and to the third customer, he sells half of what he was then left with and half an egg. However, he did not break any egg. If in the end, the vendor was left with three eggs. How many eggs did he have initially ?

(A) 26

(B) 31

(C) 39

(D) None of these

8. How many triangles are there in the given figure ?

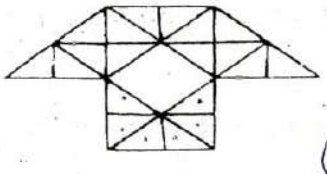

(A) 29

(B) 38

(C) 40

(D) 35

Techofworld.In

Join Us-

Download Tech Of World App WtsApp/Call- 8596976190

9. Choose the box that is similar to the box formed from the given sheet of paper :

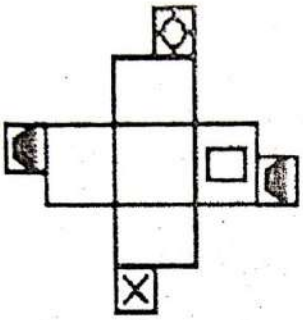

A

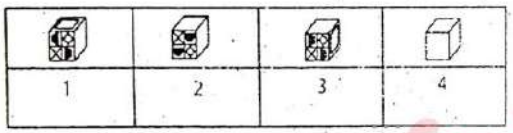

(A) 1, 2 and 3

(B) 1, 2 and 4

(C) 2 and 3

(D) 2, 3 and 4

10. Select the option in which the numbers are related in the same way as are the numbers of the following set, (24, 10, 392) :

(A) (29, 18, 242)

(B) (27, 15, 480)

(C) (26, 12, 369)

(D) (21, 18, 234)

11. There are deer and peacocks in a zoo. By counting heads they are 80. The number of their legs is 200. How many peacocks are there ?

(A) 20

(B) 30

(C) 50

(D) 60

12. What day of the week was 31st January, 2007 ?

(A) Tuesday

(B) Monday

(C) Thursday

(D) Wednesday

Techofworld.in

Join Us-

Download Tech Of World App WtsApp/Call- 8596976190

13. Arrange the following words in the order in which they appear in an English dictionary :

(I) Meticulous

(II) Metric

(III) Method

(IV) Mettle

(V) Meter

(A) (V), (III), (I), (IV), (II)

(B) (V), (III), (I), (II), (IV)

(C) (III), (IV), (V), (I), (II)

(D) (V), (I), (III), (II), (IV)

14. Rasik walked 20m towards north. Then he turned right and walks 30m. Then he turns right and walks 35m. Then he turns left and walks 15m. Finally he turns left and walks 15m. In which direction and how many metres is he from the starting position ?

(A) 15m West

(B) 30m East

(C) 30m West

(D) 45m East

15. How is 'sure' written in a code language ?

I. 'he is sure' written as 'ja ha main in that code language

II. ' is she sure' written as 'Ka ja main in that code language

(A) Ja

(B) Ja or ma

(C) Ma

(D) Ha

16. Pointing to a woman, Nirmal said, "She is the daughter of my wife's grandmother's only child". How is the woman related to Nirmal if she is not the wife of Nirmal ?

(A) Wife

(B) Sister-in-law

(C) Sister

(D) None of these

Techofworld.in

Join Us-

Download Tech Of World App WtsApp/Call- 8596976190

17. IF ZIP = 198 and ZAP = 246, then how will you code VIP ?

(A) 174

(B) 222

(C) 888

(D) 990

Directions (Q. Nos. 18 to 20) : *Read the information given below to answer these questions :*

Rani and Shreshtha are a married couple having two daughters, Medha and Deepti. Deepti is married to Anurag who is the son of Garima and Tarun. Nidhi is the daughter of Anurag. Komal, who is Anurag's sister, is married to Harshit and has two sons, Aman and Prem. Prem is the grandson of Garima and Tarun.

18. What is the relationship between Aman and Nidhi ?

(A) Cousins

(B) Husband-Wife

(C) Father-Daughter

(D) Uncle-Niece

19. How is Komal related to Deepti ?

(A) Aunt

(B) Sister-in-law

(C) Sister

(D) None of these

20. Which of the following is true ?

(A) Tarun is Deepti's maternal uncle

(B) Aman is the son of Medha

(C) Garima is Harshit's mother-in-law

(D) Nidhi is cousin of Komal

21. In a cetain code, MOTHER is written as ONHURF. How will ANSWER be written in that code ?

(A) NBXSSE

(B) NBWRRF

(C) MAVSPE

(D) NBWTRF

Techofworld.in

Join Us-

Download Tech Of World App WtsApp/Call- 8596976190

22. Find the odd one out :

(A) Platform

(B) Dock

(C) Bus-stand

(D) Park

23. Find the odd one out :

(A) Lion

(B) Tiger

(C) Fox

(D) Deer

24. A doctor said to his compounder "I go to see the patients at their residence after every 3 hours 30 minutes. I have already gone to the patient 1 hour 20 minutes ago and next time I shall go at 1 : 40 P.M." At what time this information was given to the compounder by the doctor ?

(A) 11 : 30 A. M.

(B) 11 : 20 A. M.

(C) 10 : 10 A. M.

(D) None of these

25. If in the word SEPTUAGENARIAN first three and then next three letters are written in reverse order and the rest of the letters are written as they appear in English alphabet, the positions of how many letters get changed in the new arrangement ?

(A) Nil

(B) 2

(C) 10

(D) 12

26. How many rhombuses are in the figure ?

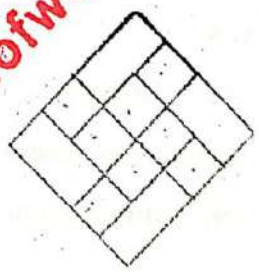

(A) 16

(B) 13

(C) 14

(D) 17

Techofworld.in

Join Us-

Download Tech Of World App WtsApp/Call- 8596976190

27. What is the minimum number of different colours required to paint the given figure such that no two adjacent regions have the same colour ?

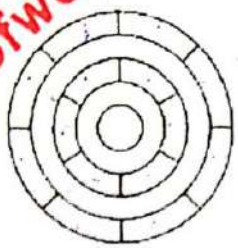

(A) 3

(B) 4

(C) 5

(D) 6

28. Seven years from now, Anamika will be as old as Malini was 4 years ago. Srinidhi was born 2 years ago. The average age of Anamika, Malini and Srinidhi 10 years from now will be 33 years. What is the present age of Anamika ?

(A) 30 years

(B) 31 years

(C) 29 years

(D) 28 years

29. Nurture : Neglect :: Denigrate : ?

(A) Reveal

(B) Extol

(C) Recognise

(D) Calumlnate

Directions (Q. Nos. 30 to 32) : *In each of the following questions, one term in the number series is wrong. Find out the wrong term.*

30. 1, 3, 12, 25, 48 :

(A) 3

(B) 12

(C) 25

(D) 48

31. 105, 85, 60, 30, 0, – 45, – 90 :

(A) 105

(B) 60

(C) 0

(D) – 45

32. 325, 259, 204, 160, 127, 105, 96

(A) 325

(B) 127

(C) 105

(D) 96

Techofworld.In

Join Us-

Download Tech Of World App WtsApp/Call- 8596976190

33. Latex is related to Rubber as Flax is to _____.

(A) Linen

(B) Wool

(C) Jute

(D) Cotton

34. In a certain code language, "GOAT" is written as "45" and "COAT" is written as "41". How is "BOAT" written in that code language ?

(A) 40

(B) 41

(C) 42

(D) 43

35. In a certain code language, TUTORIAL is written as DODNGLCF and DANCE is written as YCJMZ, how is EDUCATION written in that code ?

(A) ZYMODCLNJ

(B) ZYOMCDLNJ

(C) ZYOMDCLNJ

(D) ZYOTNLCMD

36. The door of Aditya's house faces the East. From the back side of his house, he walks straight 50 meters, then turns to the right and walks 50 meters again. Finally, he turns towards left and stops after walking 25 meters. Now, Aditya is in which direction from the starting point ?

(A) South-East

(B) North-East

(C) South-West

(D) North-West

37. A man is facing towards West and turns through 45° clock-wise, again 180° clock-wise and then turns through 270° anti clock-wise. In which direction is he facing now ?

(A) West

(B) North-West

(C) North

(D) South-West

Techofworld.In

Join Us-

Download Tech Of World App WtsApp/Call- 8596976190

38. In a row of thirty boys, R is 4th from right end and W is 10th from the left end. How many boys are there between R and W ?

(A) 15

(B) 16

(C) 17

(D) Cannot be determined

39. How many cubes are there in the figure ?



(A) 15

(B) 9

(C) 12

(D) 8

40. Three positions of a dice are given. Find out which number is found opposite the number 2 in the given cube ?

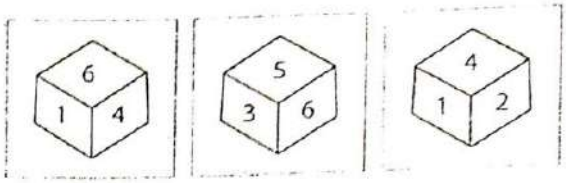

(A) 6

(B) 5

(C) 3

(D) 1

Directions (Q. Nos. 41 & 42) : *These questions are based on five words given below :*

THE MOD CPU RAM SHE

41. If the third alphabet in each of the word is changed to the next alphabet in English alphabetical order, how many words thus formed have more than two vowel ?

(A) None

(B) One

(C) Two

(D) Three

Techofworld.In

Join Us-

Download Tech Of World App WtsApp/Call- 8596976190

42. If the given words are arranged in the order as they would appear in the English dictionary from left to right, which of the following will be the fourth from the left ?

(A) THE

(B) MOD

(C) CPU

(D) RAM

43. Select the option in which the numbers are related in the same way as are the numbers of the following set, (24, 10, 392) :

(A) (29, 18, 242)

(B) (27, 15, 480)

(C) (26, 12, 369)

(D) (21, 18, 234)

44. If REQUEST is written as S2R52TU, then how will ACID be written ?

(A) 1394

(B) IC94

(C) BDJE

(D) ID3E

45. Nandini is the only daughter of Madan's sister Sangita's brother. How is Nandini related to Madan ?

(A) Daughter

(B) Niece

(C) Cousin

(D) Niece or Daughter

46. Choose the alternative which closely resembles the mirror image of the given combination :

TARAIN1014A

(I) A4↑0↑NIARAT

(II) A↑0↑4NIARAT

(III) A↑0↑4TARAIN

(IV) A4↑0↑NIARAT

(A) 1

(B) 2

(C) 3

(D) 4

Join Us-

Download Tech Of World App WtsApp/Call- 8596976190

47. Choose the correct water image of the question figure, from the given answer figures (assume that water is along XY) :

Question figure :

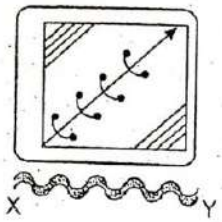

Answer figures :

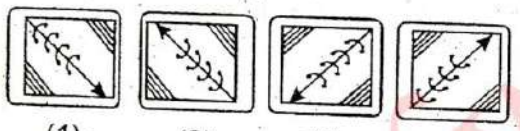

(A) 1

(B) 2

(C) 3

(D) 4

48. Choose the correct mirror image from the answer figures (a), (b), (c) and (d) :

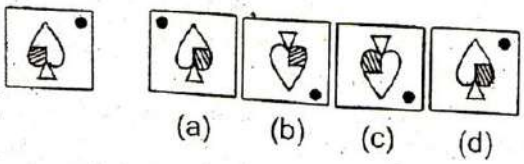

(A) (a)

(B) (b)

(C) (c)

(D) (d)

49. How many rectangles are there in the given diagram ?

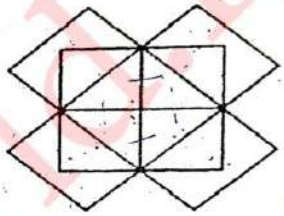

(A) 20

(B) 26

(C) 21

(D) 14

50. A clock seen through a mirror show quarter past three. What is the correct time shown by the clock ?

(A) 9 : 45

(B) 9 : 15

(C) 8 : 45

(D) 3 : 15

Techofworld.in

Join Us-

Download Tech Of World App WtsApp/Call- 8596976190

(B) MATHEMATICS

51. $\frac{1}{1.3} + \frac{1}{3.5} + \frac{1}{5.7} + \frac{1}{7.9} = ?$

(A) 5/11

(B) 6/11

(C) 9/4

(D) 4/9

52. Determine the smallest 3-digit number which is exactly divisible by 6 and 12 ?

(A) 96

(B) 84

(C) 108

(D) 120

53. What is the HCF of 1/5, 2/7 and 3/11 ?

(A) 1/385

(B) 6

(C) 1/35

(D) 5/77

54. 0.03 × 0.0165 is equal to :

(A) 4.95×10^{-3}

(B) 4.95×10^{-4}

(C) 4.95×10^{-5}

(D) 4.95×10^{-6}

55. $\frac{(799 + 267)^2 - (799 - 267)^2}{799 \times 267} = ?$

(A) 532

(B) 1066

(C) 2

(D) 4

56. $\overline{0.68} + \overline{0.73} = ?$

(A) $\overline{1.41}$

(B) $\overline{1.42}$

(C) $\overline{0.141}$

(D) None of these

Techofworld.In

Join Us-

Download Tech Of World App WtsApp/Call- 8596976190

57. Two numbers are 20% and 40% more than the third number respectively. The ratio of first and second number is :

(A) 7 : 6

(B) 7 : 5

(C) 6 : 7

(D) 5 : 7

58. A fruit seller had some oranges. He sells 30% oranges and still has 140 oranges. Originally he had :

(A) 140 oranges

(B) 420 oranges

(C) 200 oranges

(D) 60 oranges

59. 11 oranges are bought for Rs. 10 and 10 oranges for Rs. 11. What is the gain in percentage ?

(A) 11%

(B) 21%

(C) 25%

(D) 28%

60. The difference between Compound Interest and Simple Interest for 2 years at 5% per annum is Rs. 2.50. Find the sum :

(A) 500

(B) 1500

(C) 1000

(D) None of these

61. A can finish a work in 18 days and B can do the same work in 15 days. B worked for 10 days and left the job. In how many days will 10 women complete it ?

(A) 5

(B) $5\frac{1}{2}$

(C) 6

(D) 8

Techofworld.In

Join Us-

Download Tech Of World App WtsApp/Call- 8596976190

62. The ratio between the speeds of two trains is 7 : 8. If the second train runs 400 kms in 4 hours, then the speed of first train is :

(A) 70 km / h

(B) 75 km / h

(C) 84 km / h

(D) 87.5 km / h

63. $\sqrt{1.5625}$ = ?

(A) 1.05

(B) 1.25

(C) 1.45

(D) 1.55

64. If α and β are the roots of quardatic equation such that $\alpha + \beta = 12$ and $\alpha - \beta = 4$, then the equation is :

(A) $x^2 - 12x + 32 = 0$

(B) $x^2 - 12x - 32 = 0$

(C) $x^2 + 12x + 32 = 0$

(D) $x^2 + 12x - 32 = 0$

65. If for $p \neq 1$, $p^{5x+3} = 1$ then x = ?

(A) $-2/5$

(B) 3/5

(C) $-3/5$

(D) 2/5

66. If n is a natural number, then $(6n^2 + 6n)$ is always divisible by :

(A) 6 only

(B) 6 and 12 only

(C) 12 only

(D) 18 only

67. If $\frac{x}{5} = \frac{y}{9}$ then (x + 5) : (y + 9) = ?

(A) 3 : 5

(B) 13 : 8

(C) 5 : 9

(D) 9 : 5

Techofworld.In

Join Us-

Download Tech Of World App WtsApp/Call- 8596976190

68. The fourth proportional to 5, 8, 15 is :

(A) 18

(B) 21

(C) 19

(D) 24

69. If $\begin{vmatrix} x+y & y \\ 3-x & 3 \end{vmatrix} = \begin{vmatrix} 2 & -1 \\ 0 & 3 \end{vmatrix}$ then the value of x and y is :

(A) 3, – 1

(B) – 3, – 1

(C) – 3, 1

(D) 3, 1

70. If $M = \begin{vmatrix} -1 & 0 \\ 2 & 3 \end{vmatrix}$, $N = \begin{vmatrix} 0 & -2 \\ -2 & 3 \end{vmatrix}$, then 2M + N is :

(A) $\begin{vmatrix} -2 & -2 \\ 2 & 6 \end{vmatrix}$

(B) $\begin{vmatrix} -2 & -2 \\ -2 & 9 \end{vmatrix}$

(C) $\begin{vmatrix} -2 & 2 \\ 2 & 9 \end{vmatrix}$

(D) $\begin{vmatrix} -2 & -2 \\ 2 & 9 \end{vmatrix}$

71. For what value of α does the equations $\alpha x + y = 3$, $2x - 3y = 5$ has no solution ?

(A) – 2/3

(B) 3/4

(C) 1/5

(D) 3/5

72. The discriminant of the quadratic equation $3x^2 - 5x + 3 = 0$ is :

(A) – 5

(B) 3

(C) – 11

(D) – 1

Join Us-

Download Tech Of World App WtsApp/Call- 8596976190

73. If a pair of linear equations is given by $a_1x + b_1y + c_1 = 0$ and $a_2x + b_2y + c_2 = 0$ where $\frac{a_1}{a_2} = \frac{b_1}{b_2} \neq \frac{c_1}{c_2}$ then :

(A) The pair of linear equation is consistent

(B) The pair of linear equation is inconsistent

(C) The pair of linear equation is independent

(D) The pair of linear equation is dependent

74. If the 7th and 13th terms of an A. P. be 34 and 64 respectively, then its 18th term is :

(A) 87

(B) 88

(C) 89

(D) 100

75. If the sum of n terms of an A. P. is $3n^2 + 5n$ then which of its terms is 164 ?

(A) 26th

(B) 27th

(C) 30th

(D) None of these

76. If the sum of n terms of an A. P. be $3n^2 + n$ and the common difference is 6, then its 1st term is :

(A) 2

(B) 3

(C) 1

(D) 4

77. What is the sum of all odd terms between 2 and 100 ?

(A) 2687

(B) 2600

(C) 2768

(D) 2967

Techofworld.In

Join Us-

Download Tech Of World App WtsApp/Call- 8596976190

78. In a group of 500 students, there are 475 students who can speak Hindi and 200 can speak English. What is the number of students who can speak Hindi only ?

(A) 475

(B) 300

(C) 175

(D) 500

79. In a cricket match, a batsman hits a boundary 15 times out of 60 balls he plays. Find the probability that he didn't hit a boundary in next ball :

(A) 0.75

(B) 0.15

(C) 0.60

(D) 0.18

80. Find the probability that a non-leap year has 53 Sundays :

(A) 2/7

(B) 5/7

(C) 1/7

(D) 6/7

81. If a number is selected from numbers 1 to 25, then find the probability that it is a prime number :

(A) 3/5

(B) 1/5

(C) 7/25

(D) 9/25

82. How many natural numbers are there between 23 and 100 which are exactly divisible by 6 ?

(A) 8

(B) 11

(C) 13

(D) 12

Techofworld.In

Join Us-

Download Tech Of World App WtsApp/Call- 8596976190

83. If a set has 5 elements, then the power set of that set has _____ elements.

(A) 25

(B) 32

(C) 10

(D) None of these

Techofworld.In

84. A bag contains 3 green, 4 blue and 2 orange marbles. If a marble is picked at random then find the probability of not getting an orange marble :

(A) 4/9

(B) 7/9

(C) 1/4

(D) 1/3

85. If x is any number chosen from 1, 2, 3 and y is selected from the numbers 1, 4, 9, then P(xy < 9) = ?

(A) 2/3

(B) 5/9

(C) 7/9

(D) 1/3

86. If the angle of elevation of the top of tower from a point 20m away from the foot is 45°, then find height of the tower :

(A) 40m

(B) 20m

(C) 30m

(D) 25m

87. If a circle and a semi-circle have the same radius as 14 cm, then the ratio of their perimeters is _____.

(A) 5 : 1

(B) 6 : 7

(C) 11 : 9

(D) 12 : 9

Join Us-

Download Tech Of World App WtsApp/Call- 8596976190

88. If the height of the cone is twice of the radius of its base circle then find the ratio of the area of base with total surface area :



(A) 1 : √5

(B) 2 : √3

(C) 3 : 2

(D) 4 : 3

89. A single letter is drawn at random from the word "ASPIRATION" the probability that it is a vowel is :

(A) 1/2

(B) 1/3

(C) 1/4

(D) 0

90. If 4 coins are tossed once then what is the probability of getting exactly 2 heads ?

(A) 7/8

(B) 5/8

(C) 1/2

(D) 3/8

91. A and B are two independent events such that $P(A \cup B') = 0.8$, and $P(A) = 0.3$, then $P(B) = ?$

(A) 2/7

(B) 2/3

(C) 3/8

(D) 1/8

92. Find the probability of getting a number greater than 3 in rolling of a dice once :

(A) 1/2

(B) 1/3

(C) 1/4

(D) 1/5

Techofworld.in

Join Us-

Download Tech Of World App WtsApp/Call- 8596976190

93. What is the sum of two consecutive even numbers, the difference of whose squares is 84 ?

(A) 34

(B) 38

(C) 42

(D) 46

94. What is the geometric mean of 4 and 16 ?

(A) 2

(B) 4

(C) 6

(D) 8

95. The average of 30 numbers is 12. The average of the first 20 of them is 11 and that of the next 9 is 10. The last number is :

(A) 60

(B) 45

(C) 50

(D) 40

96. The average of two numbers A and B is 20, that of B and C is 19 and of C and A is 21. What is the value of A ?

(A) 20

(B) 24

(C) 22

(D) 18

97. Find the sum of deviations of the variate values 3, 4, 6, 7, 8 and 14 from their mean ?

(A) 0

(B) 3

(C) 4

(D) 6

98. What is the mean of 1st 5 multiple of 7 ?

(A) 28

(B) 35

(C) 14

(D) 21

Techofworld.In

Join Us-

Download Tech Of World App WtsApp/Call- 8596976190

99. Find out the algebraic sum of deviation of a set of P values from their mean :

(A) P – 1

(B) 0

(C) P

(D) P + 1

100. The median of the following data :

Class interval	Frequency
0 – 10	8
10 – 20	16
20 – 30	36
30 – 40	34
40 – 50	6

(A) 27.22

(B) 24

(C) 50

(D) 36

.....

Techofworld.In

Join Us-